مدرسة الرسالة العلمية الدولية
Al Resalah International School of Science

athena Education

Mental Math Review Worksheet

Name: _____ Grade 2 ___ Date: _____

1. 40 + 2 =	
2. Which number is the greatest? (40, 14)	
3. What is the next number 35, 36 ,37	
4. 100 + ____ + 4 = 134	
5. A square has 3 equal sides? True/False	
6. Subtract 50 from 100.	
7. What fraction is shaded? 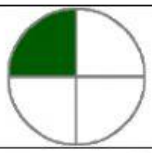	
8. In a garden, 12 butterflies were sitting on the flowers. 9 butterflies flew away. How many butterflies are left?	
9. How many vertices does this shape have? 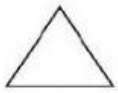	
10. Subtract 4 from 28.	
11. How many faces does a cube have?	
12. How many sides does a hexagon have?	
13. What time is it?