ACTIVIDADES LÓGICO-MATEMÁTICAS – PARTE 1

Comenzamos, como siempre, poniendo el nombre y apellidos

UNE CON LÍNEAS CADA DIBUJO CON SU SOMBRA



Miguel Ángel Bravo
Mian Brabur - 2020

¿DÓNDE HAY MÁS?

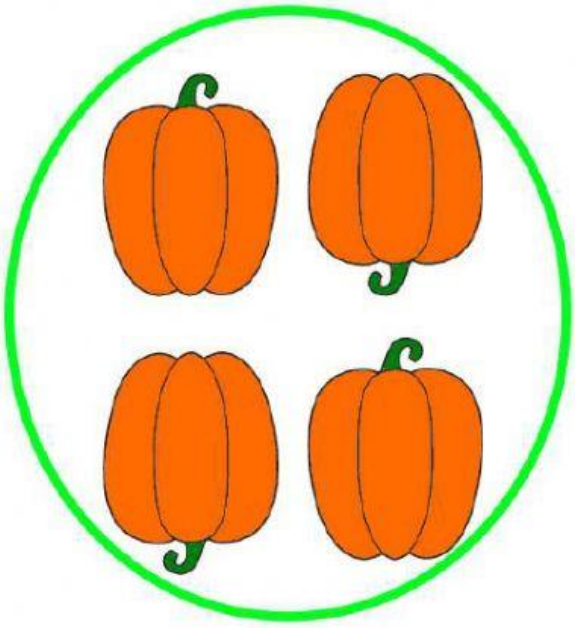

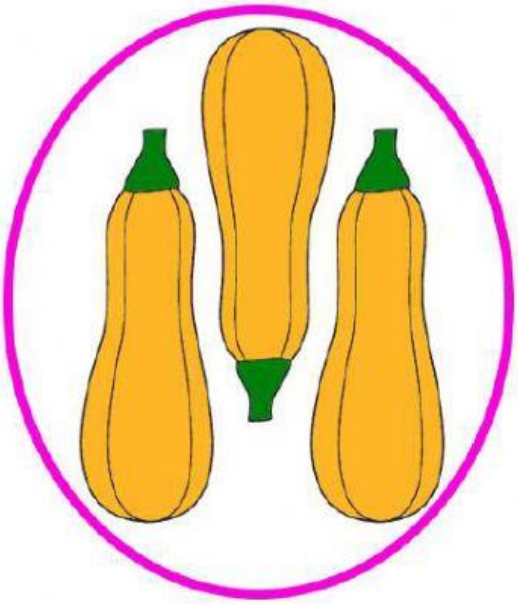

¿DÓNDE HAY MENOS?





Miguel Ángel Bravo
Mian Brabur - 2020

¿DÓNDE HAY IGUAL NÚMERO?

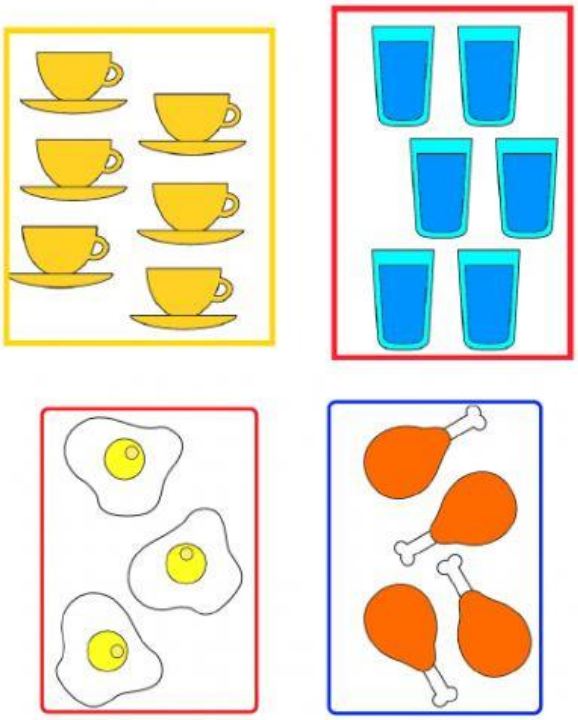

MARCA LA SOMBRA DEL ALIENÍGENA



Miguel Ángel Bravo
Mian Brabur - 2020

CUENTA Y ESCRIBE CUÁNTAS FRUTAS HAY DE CADA CLASE



ARRASTRA Y COMPLETA LAS SERIES

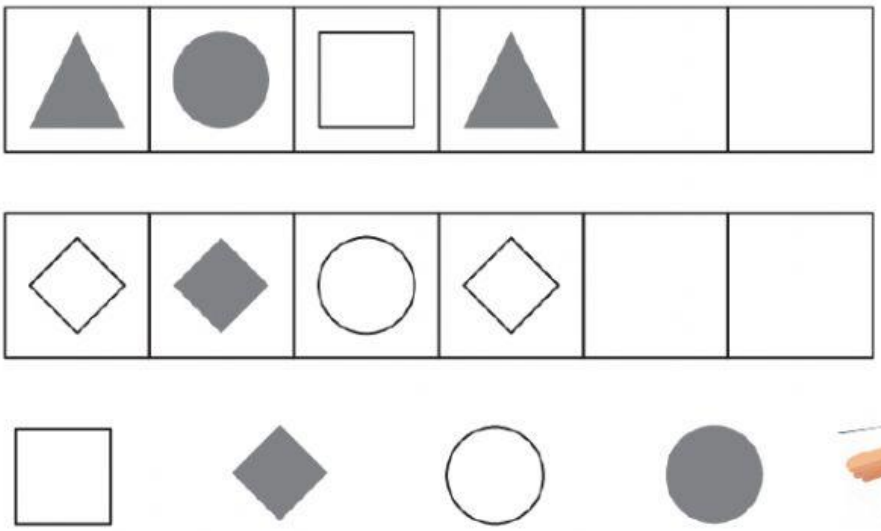

Miguel Ángel Bravo
Mian Brabur - 2020