HAZ ESTOS EJERCICIOS

1..– Calcula el área y perímetro de estas figuras y luego elige la unidad adecuada



Área = ☐ ☐

Perímetro = ☐ ☐

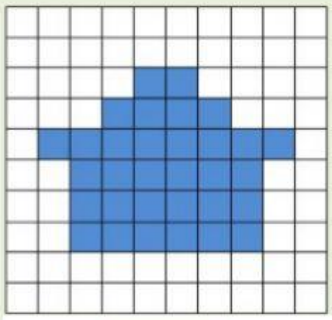

Área = ☐ ☐

Perímetro = ☐ ☐

2.-Completa esta tabla

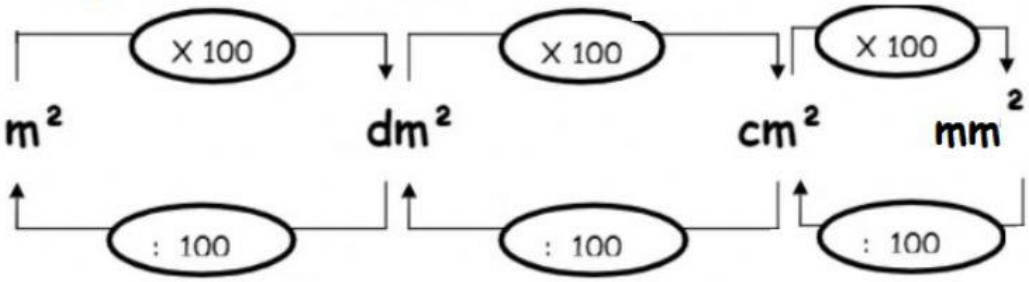

m^2	dm^2	cm^2	mm^2
2	200	20.000	2.000.000
		3.400	
	172		
			895.000
0,03			

3.- Calcula el área de estas figuras
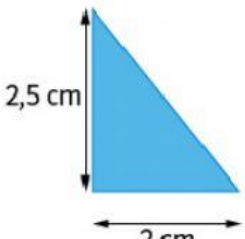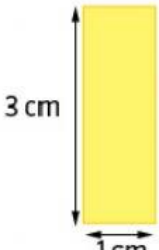
BUSCA LAS FORMULAS EN TUS APUNTES