Mathematics

Reinforcement Exercise

A. Match each image to the correct name.



line

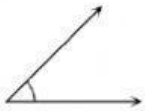

Line segment

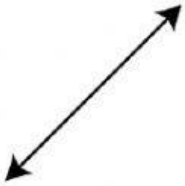

angle

ray

B. Fill in the blanks

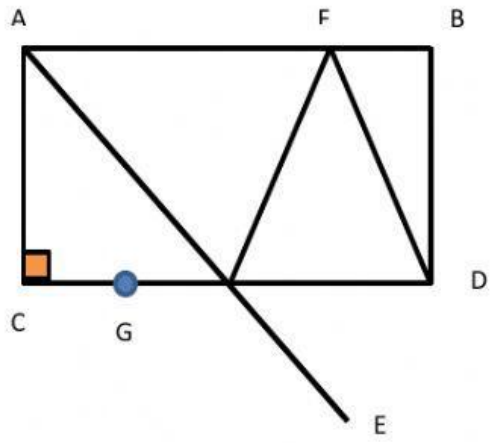

WORD BANK

(#3 - #6)

intersects

parallel

ray

point

perpendicular

1. AB is a horizontal line.

2. _____ is a vertical line.

3. G is a _____.

4. AC and BD are _____.

5. AC and CD are _____.

6. AE _____ line segment CD.

C. Name the shapes.

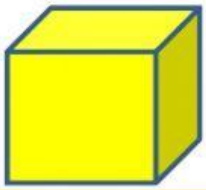

D. Name (drag) the parts identified on each shape.
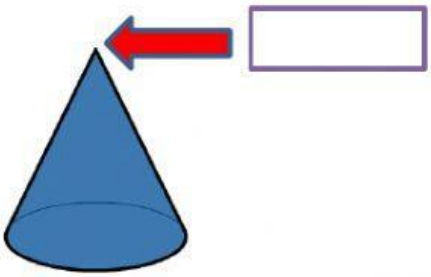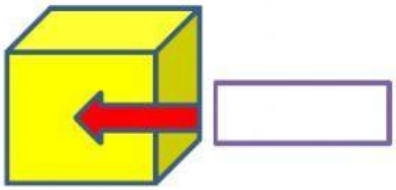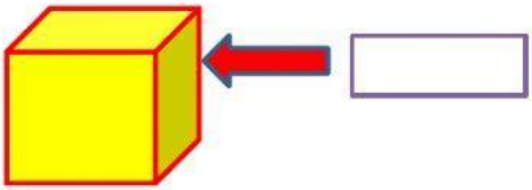
edge | vertex | box | face