# RELACIONA CADA IMATGE AMB L' ESPORT QUE ÉS



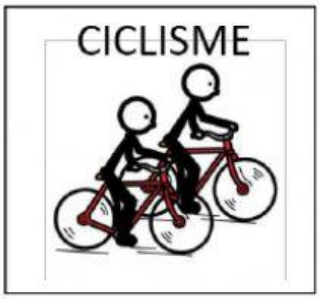

ATLETISME

HOCKEY

FUTBOL

TENNIS

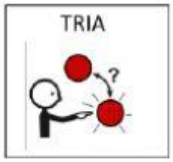


TRIA LA RESPOSTA CORRECTA SEGONS SI SÓN ESPORTS D' **EQUIP** O I**NDIVIDUALS**.

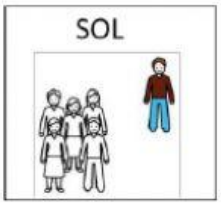







# RELACIONA CADA ESPORT AMB L' ELEMENT QUE FA SERVIR

https://es.liveworksheets.com/hd661660na