0 1 2 3 4 5 6 7 8 9 10 11 12 13 14 15 16 17 18 19 20

I count each group of ten and draw a line to the numeral it represents.

أَعُدُّ كُلَّ مَجْموعَةٍ مِنَ الْعَشَراتِ، وَأَصِلُها بِالرَّقْمِ الَّذي تُمَثِّلُه.

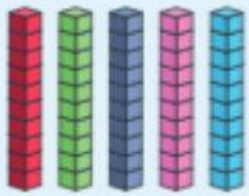

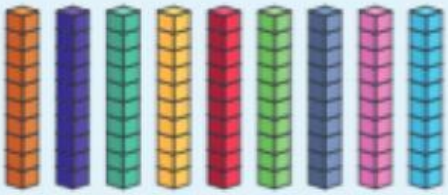

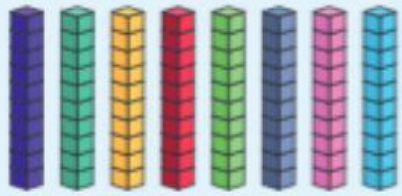

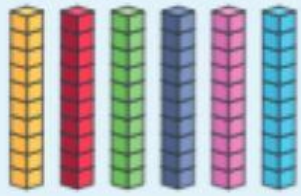

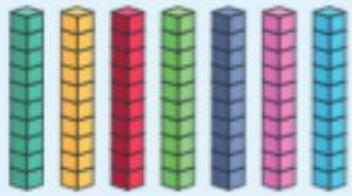

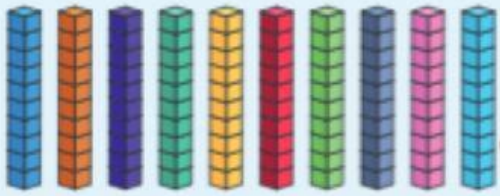

- 100
- 50
- 70
- 80
- 60
- 90

حقوق الطبع © محفوظة لوزارة التربية والتعليم - دولة الإمارات العربية المتحدة