Determine which letter best describes the shaded portion.

1)

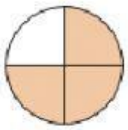

A. one-fourth
B. three quarters
C. four quarters

2)

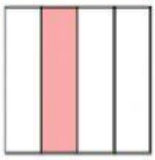

A. two halves
B. four quarters
C. one-fourth

3)



A. four-fourths
B. two halves
C. two quarters

4)



A. one quarter
B. one half
C. three-fourths

5)

A. two halves
B. one quarter
C. two quarters

6)

A. two halves
B. two quarters
C. four quarters

7)

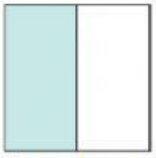

A. one quarter
B. one half
C. four-fourths

8)

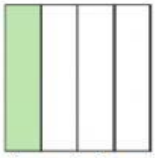

A. two halves
B. one quarter
C. one half

9)

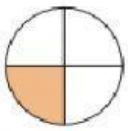

A. two quarters
B. two halves
C. one quarter

10)

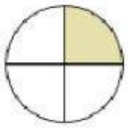

A. two halves
B. one-fourth
C. three quarters

11)

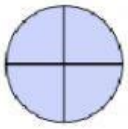

A. one half
B. four quarters
C. one quarter

12)



A. two quarters
B. two halves
C. three quarters

Answers

1. _____
2. _____
3. _____
4. _____
5. _____
6. _____
7. _____
8. _____
9. _____
10. _____
11. _____
12. _____