1.ER GRADO

¿CUÁLES RUEDAN?

● **ENCERRÁ** EN UN ◯ LOS CUERPOS GEOMÉTRICOS QUE PUEDEN RODAR.

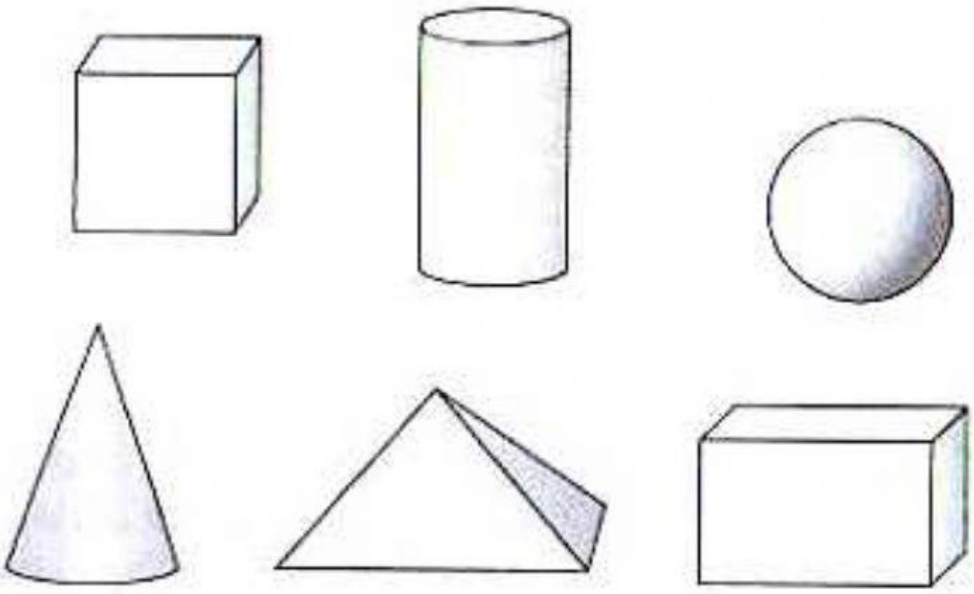

● **OBSERVÁ** ESTE DIBUJO. **CONTÁ** Y **ESCRIBÍ** CUÁNTOS HAY DE CADA UNO.



= _____

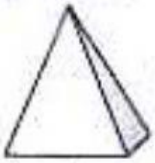 = _____

= _____

 = _____

= _____