

Hagamos cuentas con números menores

1. Escoge el grupo que tiene la misma cantidad que el grupo de niños.

A

B

C

2. Escoge el grupo que tiene la misma cantidad que el grupo de puntos

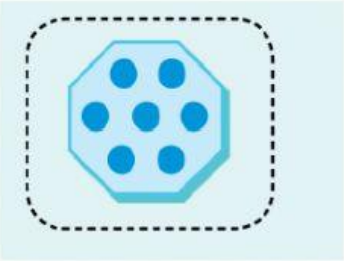

A

B

C

3. Cada se come un

¿Cuántos sobran?

LIVEWORKSHEETS

4. Cada duerme en una



¿Cuántos quedan sin ?

5. ¿Cuántos quedan?

9 comían granos. 3 levantan vuelo.

¿Cuántas siguen comiendo?

Responde las preguntas 6, 7 y 8

6 ¿Cuántos puntos se reúnen en los dados?

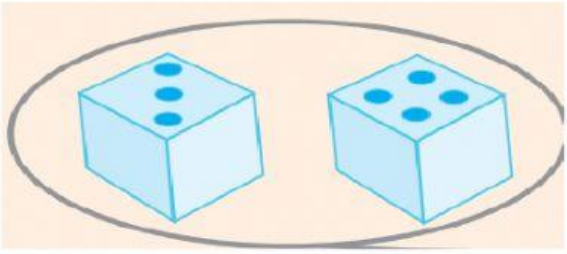

A



B



C



LIVEWORKSHEETS

7

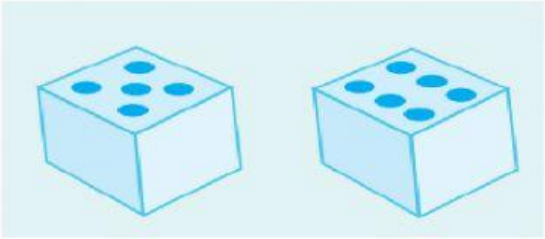

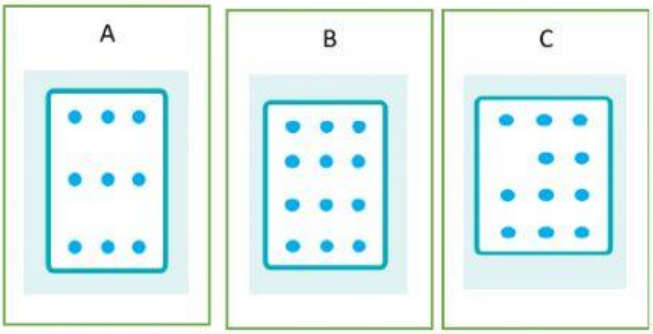

8

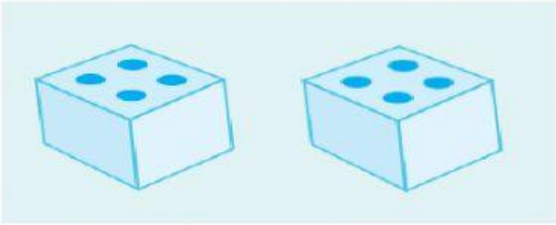

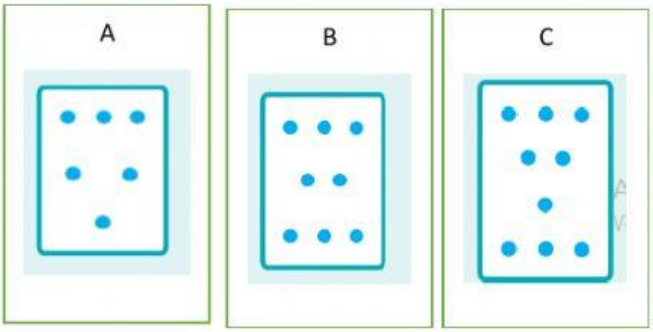

9. ¿Cuántos puntos se reúnen en los dados?

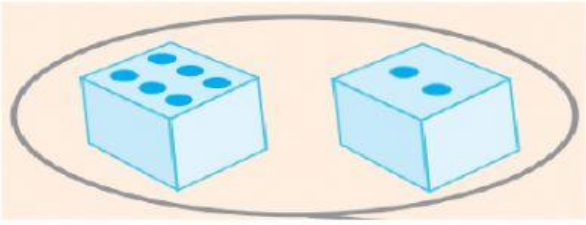

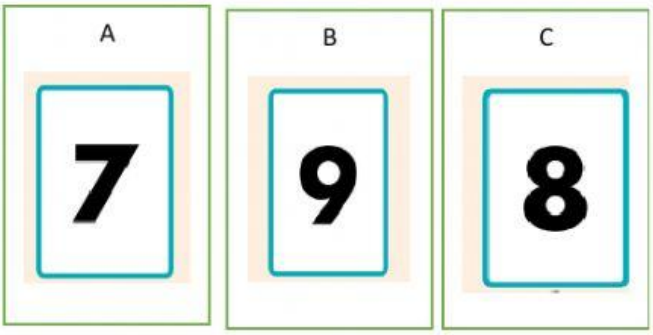

10

LIVEWORKSHEETS