Escriu la fracció que representa la part acolorida.

$\frac{2}{3}$	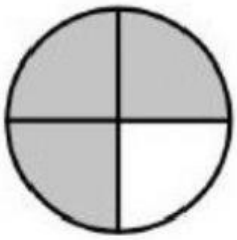 ___
 ___	___
___	___
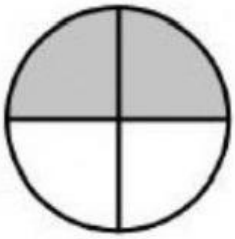 ___	 ___
___	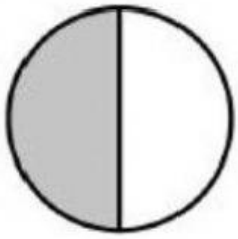 ___

LIVEWORKSHEETS