Bangun Ruang Sisi Datar

Nama :

Kelas : **VIII**

Semester : **Genap**

A. Simaklah Vidio Berikut!

B. Jawablah Pertanyaan Berikut!

No	Nama Bangun	Model Bangun	Keterangan (luas Alas 260 M^2)	
			Luas	**Ukuran**
1	Persegi	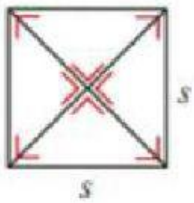	…	Hanya satu kemungkinan, yaitu S = √260
2	…	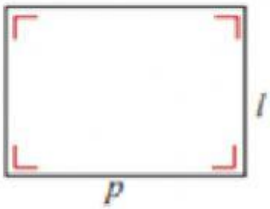	*p x l*	Sebanyak 6 kemungkinan, yakni: Luas alas = 260 cm^2

No	Panjang	Lebar
1	260	1
2	…	2
3	65	…
4	…	5
5	…	10
6	20	…

LIVEWORKSHEETS

<table>
<tr>
<td>3.</td>
<td>Jajar Genjang</td>
<td> 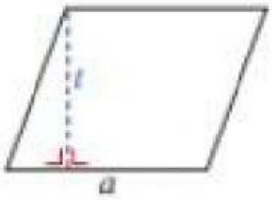
</td>
<td>a x t</td>
<td>Sebanyak 6 kemungkinan, yakni:
Luas alas = 260 cm^2
<table>
<tr><th>No</th><th>Alas</th><th>Tinggi</th></tr>
<tr><td>1</td><td>260</td><td>…</td></tr>
<tr><td>2</td><td>130</td><td>…</td></tr>
<tr><td>3</td><td>…</td><td>4</td></tr>
<tr><td>4</td><td>…</td><td>5</td></tr>
<tr><td>5</td><td>26</td><td>…</td></tr>
<tr><td>6</td><td>…</td><td>13</td></tr>
</table></td>
</tr>
<tr>
<td>4.</td>
<td>…</td>
<td> 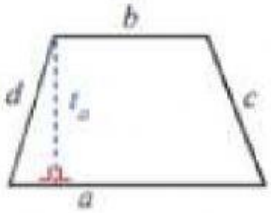
</td>
<td>½ (a + b) × t</td>
<td>Luas alas = 260 cm^2 (a + b) × t = 520
<table>
<tr><th>No</th><th>(a + b)</th><th>t</th></tr>
<tr><td>1</td><td>520</td><td>…</td></tr>
<tr><td>2</td><td>260</td><td>…</td></tr>
<tr><td>3</td><td>…</td><td>4</td></tr>
<tr><td>4</td><td>…</td><td>5</td></tr>
<tr><td>5</td><td>65</td><td>…</td></tr>
<tr><td>6</td><td>…</td><td>13</td></tr>
<tr><td>7</td><td>40</td><td>…</td></tr>
<tr><td>8</td><td>26</td><td>20</td></tr>
</table></td>
</tr>
</table>

LIVEWORKSHEETS