# MATEMÁTICAS

1. Completa el diagrama y las relaciones

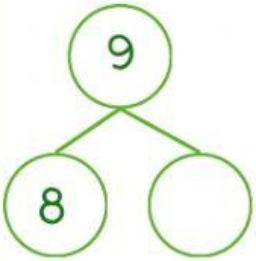


8 + ☐ = 9
9 - 1 = ☐
9 - 8 = ☐

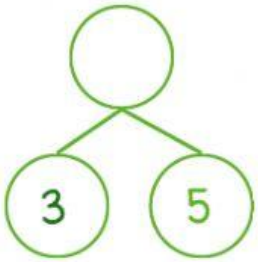


5 + 3 = ☐
8 - 3 = ☐
8 - 5 = ☐

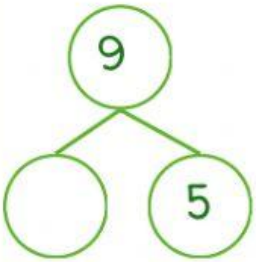


5 + ☐ = 9
9 - 4 = ☐
9 - 5 = ☐

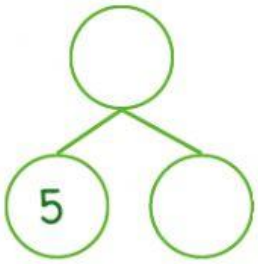


5 + ☐ = 7
7 - 5 = ☐
7 - 2 = ☐

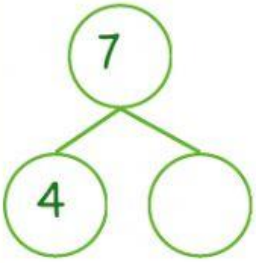


4 + ☐ = 7
7 - 4 = ☐
7 - 3 = ☐

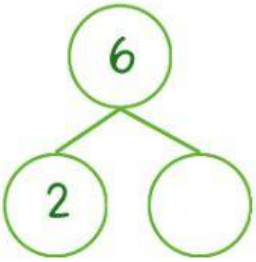


2 + ☐ = 6
6 - 2 = ☐
6 - 4 = ☐

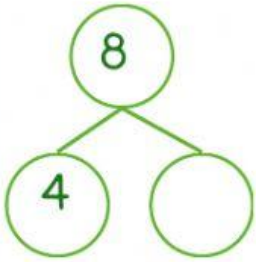


4 + ☐ = 8
8 - 4 = ☐
8 - 4 = ☐



3 + ☐ = 6
6 - 3 = ☐
6 - 3 = ☐

LIVEWORKSHEETS

5 - 2 =

2 + ☐

6 - 2 =

2 + ☐

6 - 3 =

3 + ☐

3 - 1 =

1 + ☐

4 - 3 =

3 + ☐

7 - 3 =

3 + ☐

7 - 2 =

2 + ☐

5 - 1 =

1 + ☐

8 - 2 =

2 + ☐

3 - 1 =

1 + ☐

LIVEWORKSHEETS