Name: _____

Date: _____

Score: _____

TEAM PRACTICE #4

Classify Polygons & Quadrilaterals By their attributes

Exam: Classified, named, and counted the Figures?

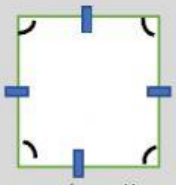

2D ✓ 3D ✗
S 4 V 4
P ✓ Q ✓
N: Square

2D ✓ 3D ✗
S 3 V 3
P ✓ Q ✗
N: Triangle

4

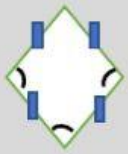

2D ✓ 3D ✗
S 4 V 4
P ✓ Q ✓
N: Rhombus

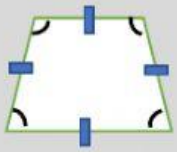

2D ✓ 3D ___
S 4 V 4
P ✓ Q ✓
N: Trapezoid

2D ✓ 3D ✗
S 4 V 4
P ✓ Q ✓
N: Rhombus

COUNTING LIST

✓ 1 Square
✓ 1 Triangle
✓ 2 Rhombus
✓ 1 Trapezoid

1) Classify, name, and count the Figures?

2D__ 3D___
S___ V___
P___ Q__
N:_____

2D__ 3D___
S___ V___
P___ Q__
N:_____

2D__ 3D___
S___ V___
P___ Q__
N:_____

2D__ 3D___
S___ V___
P___ Q__
N:_____

2D__ 3D___
S___ V___
P___ Q__
N:_____

COUNTING LIST

✓ _____
✓ _____
✓ _____
✓ _____

2) Classify, name, and count the Figures?

2D__ 3D___
S___ V___
P___ Q__
N:_____

2D__ 3D___
S___ V___
P___ Q__
N:_____

2D__ 3D___
S___ V___
P___ Q__
N:_____



2D__ 3D___
S___ V___
P___ Q__
N:_____

2D__ 3D___
S___ V___
P___ Q__
N:_____

COUNTING LIST

✓ _____
✓ _____
✓ _____
✓ _____

3) Classify, name, and count the Figures?

2D__ 3D___
S___ V___
P___ Q__
N:_____

2D__ 3D___
S___ V___
P___ Q__
N:_____

2D__ 3D___
S___ V___
P___ Q__
N:_____



2D__ 3D___
S___ V___
P___ Q__
N:_____

2D__ 3D___
S___ V___
P___ Q__
N:_____

COUNTING LIST

✓ _____
✓ _____
✓ _____
✓ _____

LIVEWORKSHEETS

4) Classify, name, and count the Figures?

2D__ 3D___
S___ V___
P___ Q __
N:_____

COUNTING LIST

✓ _____
✓ _____
✓ _____
✓ _____

5) Classify, name, and count the Figures?

2D__ 3D___
S___ V___
P___ Q __
N:_____

COUNTING LIST

✓ _____
✓ _____
✓ _____
✓ _____

6) Classify, name, and count the Figures?

2D__ 3D___
S___ V___
P___ Q __
N:_____

COUNTING LIST

✓ _____
✓ _____
✓ _____
✓ _____

6) Classify, name, and count the Figures?

2D__ 3D___
S___ V___
P___ Q __
N:_____

COUNTING LIST

✓ _____
✓ _____
✓ _____
✓ _____

LIVEWORKSHEETS