Completa con el nombre de los elementos de estos poliedros.

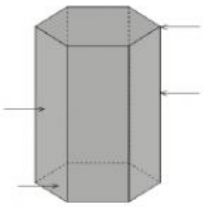

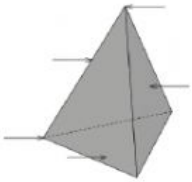

COMPLETA: CONO, CUBO, TETRAEDRO, PRISMA PENTAGONAL , CILINDRO Y ESFERA.

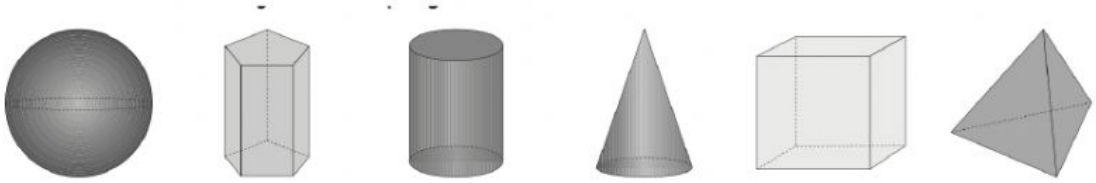

Relaciona cada poliedro con su nombre.

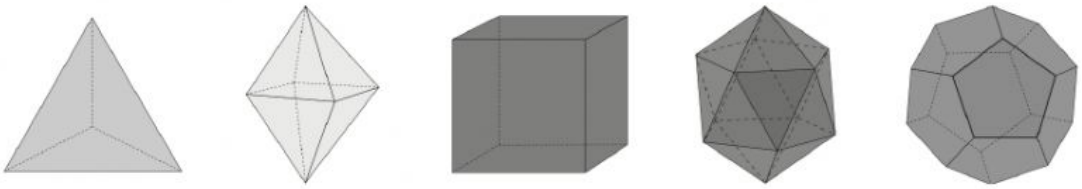

Hexaedro | Icosaedro | Tetraedro | Dodecaedro | Octaedro

ESCRIBE ENCIMA SI SON: CUERPOS REDONDOS, POLIEDROS REGULARES O POLIEDROS IRREGULARES

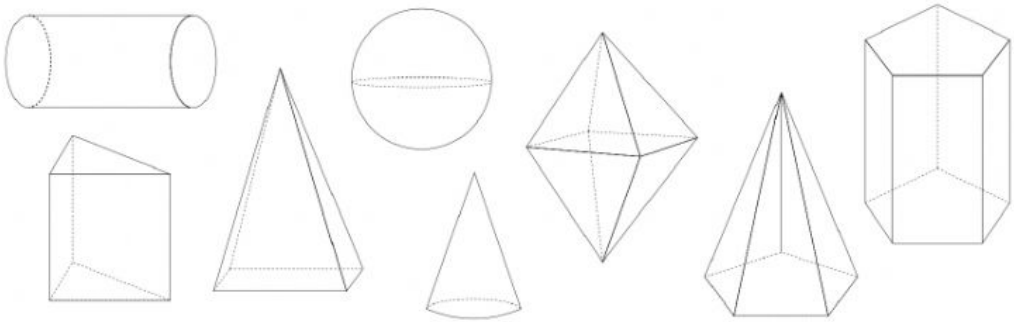

Completa la siguiente tabla sobre los poliedros regulares.

Poliedro regular		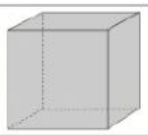			
Nombre					
Tipo de caras					
Número de caras					
Número de aristas					
Número de vértices					