ÁREA Y PERÍMETRO

INSTRUCCIONES: Calcular el área y perímetro de las siguientes figuras.

PERÍMETRO		ÁREA	
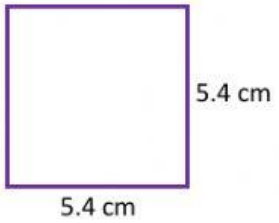 Perímetro: _____ cm	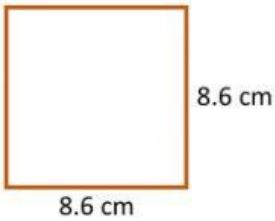 Perímetro: _____ cm	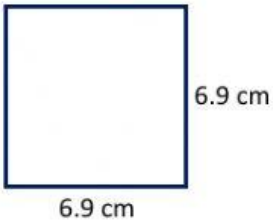 Área: _____ cm²	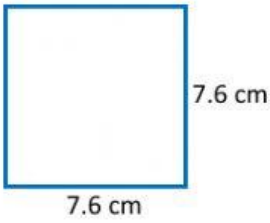 Área: _____ cm²
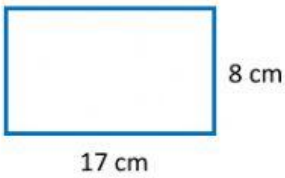 Perímetro: _____ cm	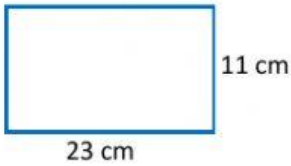 Perímetro: _____ cm	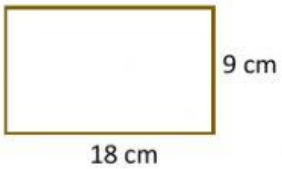 Área: _____ cm²	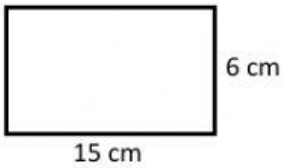 Área: _____ cm²
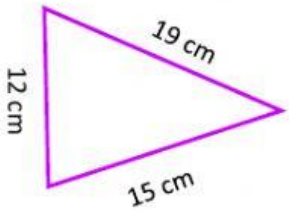 Perímetro: _____ cm	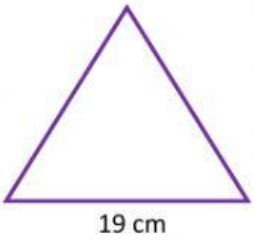 Perímetro: _____ cm	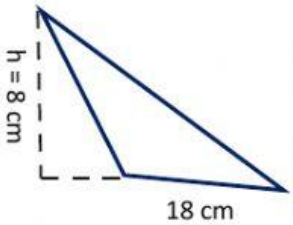 Área: _____ cm²	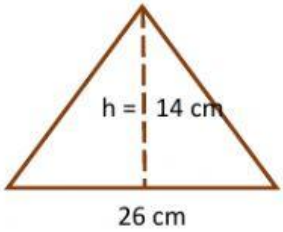 Área: _____ cm²
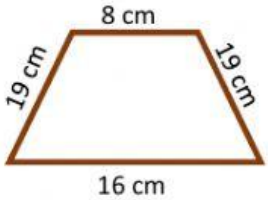 Perímetro: _____ cm	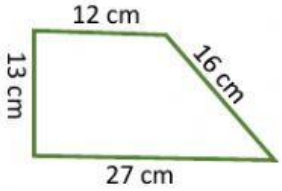 Perímetro: _____ cm	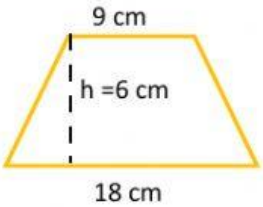 Área: _____ cm²	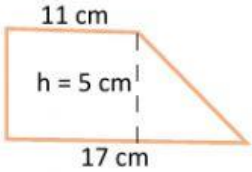 Área: _____ cm²
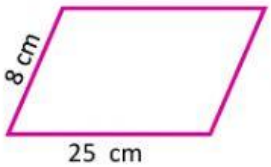 Perímetro: _____ cm	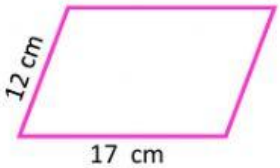 Perímetro: _____ cm	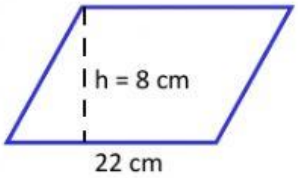 Área: _____ cm²	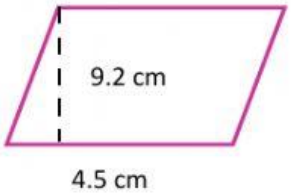 Área: _____ cm²

LIVEWORKSHEETS
LIVEWORKSHEETS

ÁREA Y PERÍMETRO

INSTRUCCIONES: Calcular el área y perímetro de las siguientes figuras.

PERÍMETRO		ÁREA	
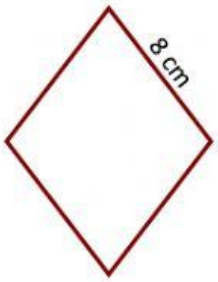 Perímetro: _____ cm	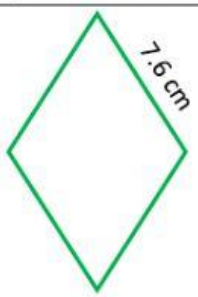 Perímetro: _____ cm	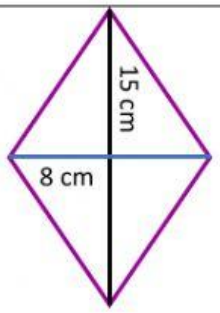 Área: _____ cm²	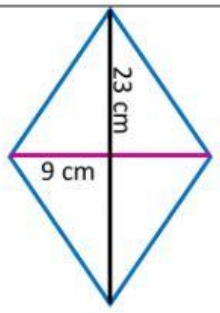 Área: _____ cm²
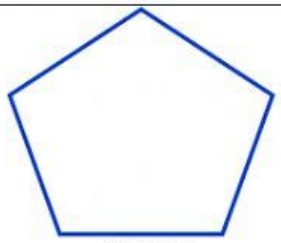 Perímetro: _____ cm	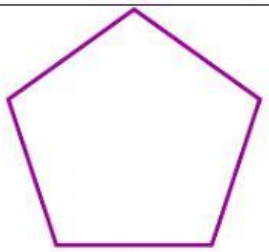 Perímetro: _____ cm	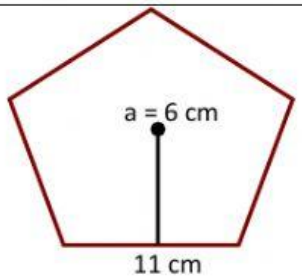 Área: _____ cm²	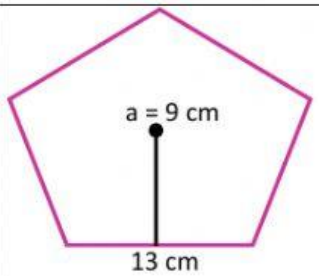 Área: _____ cm²
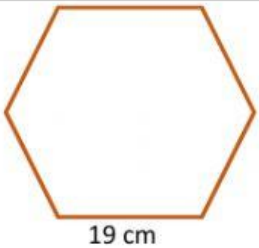 Perímetro: _____ cm	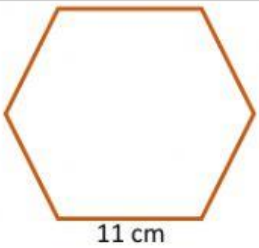 Perímetro: _____ cm	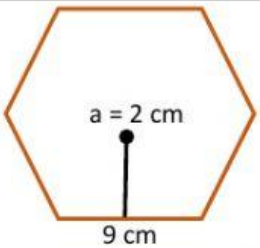 Área: _____ cm²	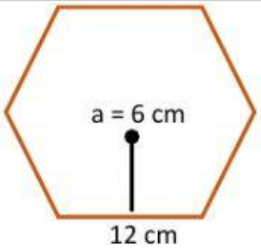 Área: _____ cm²
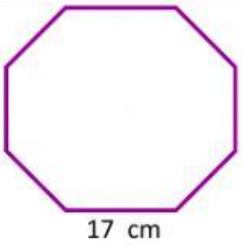 Perímetro: _____ cm	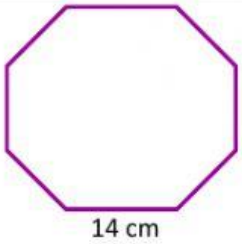 Perímetro: _____ cm	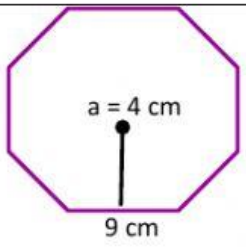 Área: _____ cm²	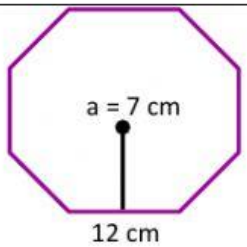 Área: _____ cm²
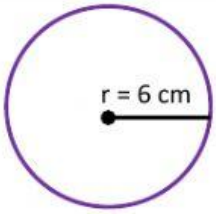 Perímetro: _____ cm	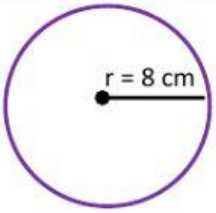 Perímetro: _____ cm	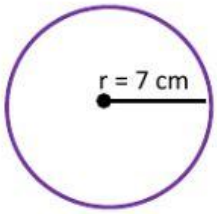 Área: _____ cm²	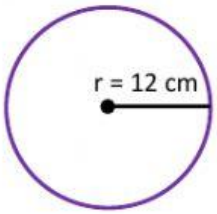 Área: _____ cm²

LIVEWORKSHEETS
LIVEWORKSHEETS