ගණිතය

පහත රූපවල අඳුරුකල පෙදෙස මුලු රූපයෙන් කොපමන කොටසක් නිරූපනය කරයිද

නම - පන්තිය-

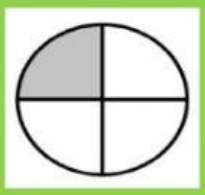

—



—

—

—

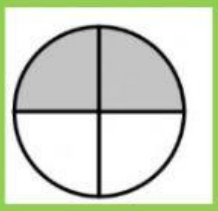

—

—

—



—

LIVEWORKSHEETS