6- QUAL É A SOMA DOS DOMINÓS?



3 + 3 = 6



__ + __ = __



__ + __ = __



__ + __ = __



__ + __ = __



__ + __ = __



__ + __ = __

LIVEWORKSHEETS