11. AREA AND ITS BOUNDARY

Class: V Worksheet - 6 Subject: Maths

Name:_____ Date: _____

Find the area by counting the squares.

1. 

Area: _____

2. 

Area: _____

3. 

Area: _____

4. 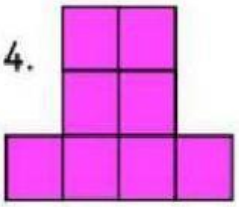

Area: _____

5. 

Area: _____

6. 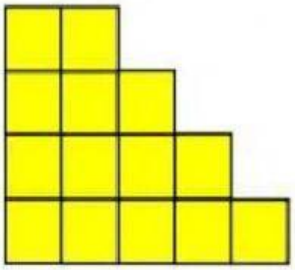

Area: _____

Find the area by multiplying the length x width.

7. 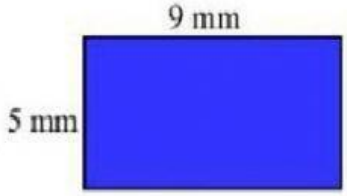

Area: _____ mm^2

8. 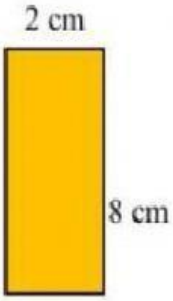

Area: _____ cm^2

9. 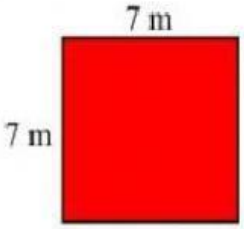

Area: _____ m^2

LIVEWORKSHEETS