PARALLELOGRAMS

01.Match the followings

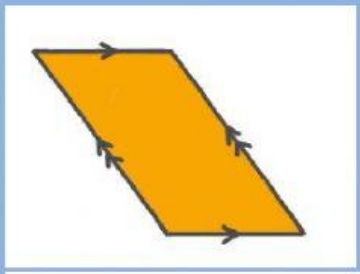

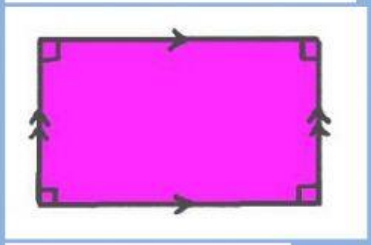

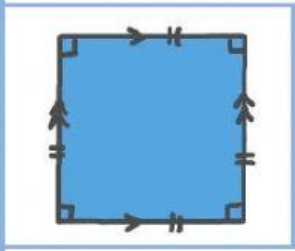

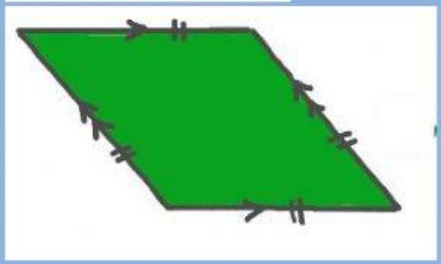

Square

Rhombus

Parallelogram

Rectangle

02.Put "$true$" for correct answer and "$false$" for wrong answer.

- Opposite sides of parallelogram are equal to each other
- Diagonals of rectangle are bisecting each other perpendicularly.
- Each diagonal bisects the parallelogram into two congruent triangles

LIVEWORKSHEETS