NATURAL SCIENCE UNIT 2

NAME _____ MARK

DATE_____

1. COMPLETE THE TEXT

respond | environment | detect | external

Sensitivity is the ability to ..... and .....

to changes in our ..... These changes are called

..... stimuli.

2. COMPLETE:

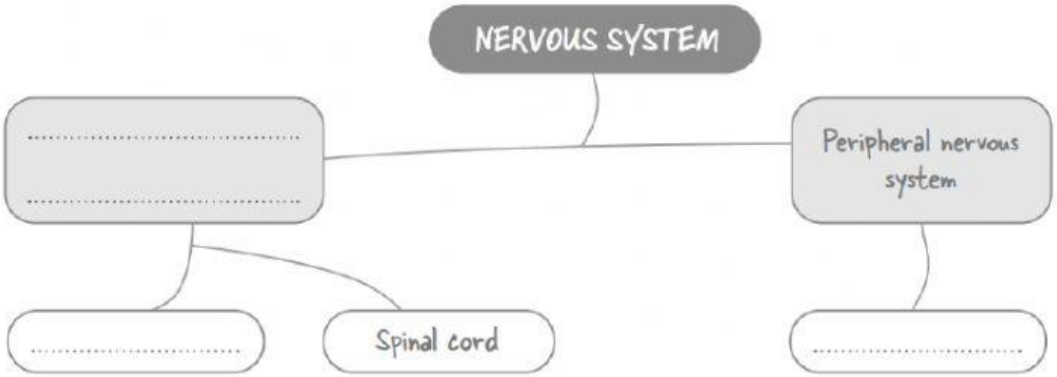

3. COMPLETE THE PARTS OF A NEURON

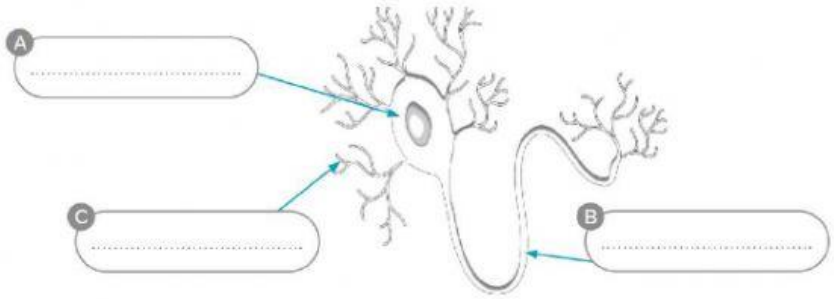

LIVEWORKSHEETS

4. MATCH

sense organs	They receive the orders and our muscles respond by moving our body.
nervous system	They contain receptors that detect external stimuli. They send the information to the nervous system.
skeletal and muscular systems	It interprets the information and sends orders that create a response.

5. COMPLETE THE TEXT USING THE WORDS IN THE BOX.

CELLS	CENTRAL	CORD	NERVES	TISSUE	PERIPHERAL

The nervous system consists of nervous_____, which is made up of nerves_____, or neurons. The nervous system has two parts:

The_____nervous system, which consists of the brain and the spinal_____

The _____nervous system, which is made of_____

6. IDENTIFY THE STIMULI AND THE RESPONSE.

a. We hear the phone ringing_____

We reach for the phone_____

b. We see that the traffic light is green for pedestrians._____

We cross the street._____

c. We hear the doorbell ring_____

We open the door._____

LIVEWORKSHEETS

7. LABEL THE PARTS OF THIS BRAIN

BRAINSTERM CEREBRUM CEREBELLUM

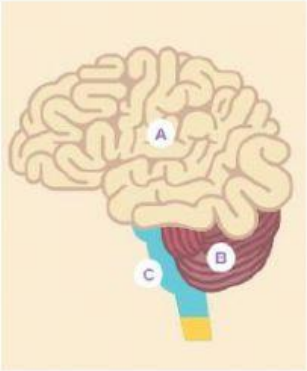

8. CHOOSE THE RIGHT ANSWER:

a. It Receives and processes information from stimuli, controls voluntary movements:

-Spinal cord

-Cerebellum

-Cerebrum

b. It controls our balance and coordinates movements.

-Cerebrum

-Brainstem

-Cerebellum

c. It regulates the functions of our internal organs.

-Cerebrum

-Cerebellum

-Brainstem

LIVEWORKSHEETS