Escriu el nom de cada polígon, el número de costats i calcula el perímetre.

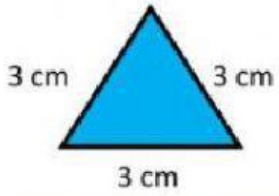


Costats:

Perímetre: cm

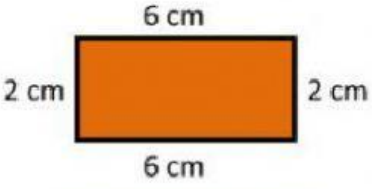


Costats:

Perímetre: cm

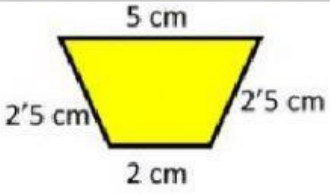


Costats:

Perímetre: cm

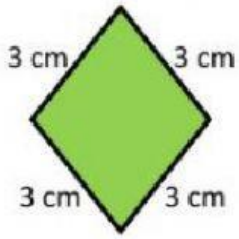


Costats:

Perímetre: cm

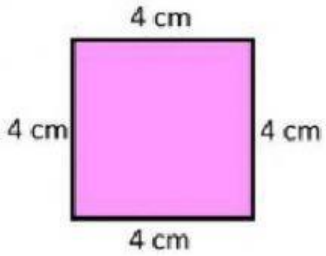


Costats:

Perímetre: cm

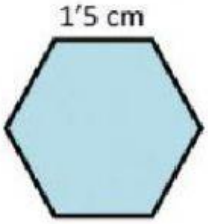


Costats:

Perímetre: cm

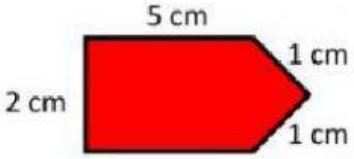


Costats:

Perímetre: cm

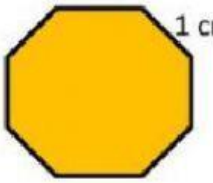


Costats:

Perímetre: cm

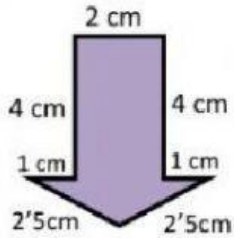


Costats:

Perímetre: cm

LIVEWORKSHEETS