# Math

## Evaluation II

1st semester School Year 2022-2023

Primary III

Starfish Academy

**Name :** **Class :**

**Date :** **Period :**

| Nilai | TTG | TTO |
|---|---|---|
| | | |

A. Choose the correct answer.

1. $\begin{array}{r} 338 \\ +164 \\ \hline \end{array}$
   a. 752
   b. 502
   c. 214

2. $\begin{array}{r} 545 \\ -385 \\ \hline \end{array}$
   a. 160
   b. 820
   c. 150

3. $\begin{array}{r} 613 \\ +\ 227 \\ \hline \end{array}$
   a. 840
   b. 270
   c. 847

4. $\begin{array}{r} 493 \\ +\ 258 \\ \hline \end{array}$
   a. 751
   b. 641
   c. 751

5. $\begin{array}{r} 681 \\ -\ 355 \\ \hline \end{array}$
   a. 266
   b. 326
   c. 936

6. 3 x 5 =
   a. 9
   b. 10
   c. 15

7. 15:3 = .....
   a. 12
   b. 3
   c. 5

8. 4 x 4 = ....
   a. 8
   b. 32
   c. 16

9. 5 x 5 = .....
   a. 10
   b. 15
   c. 25

10. 45 ..... 20
    a. <
    b. >
    c. =

11. What shape is it?
    a. hexagon
    b. pentagon
    c. rectangle

12. What shape is it?
    a. hexagon
    b. pentagon
    c. rectangle

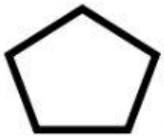

13. The amount is ...
    a. 4 cents
    b. 6 cents
    c. 12 cents

14. 32 ..... 23
    a. >
    b. <
    c. =

15. The correct even numbers are .....
    a. 5, 7, 6
    b. 2, 4, 8
    c. 3, 5, 9

16. Number 11 is .....
    a. Odd number
    b. Even number
    c. Not odd numbers

LIVEWORKSHEETS

17. Which is not a polygon?

a. b. c.

18. 473 Number 3 is in the ..... place.

a. ones
b. hundreds
c. tens

19. Seven hundred twenty one is ...

a. 700201
b. 271
c. 721

20. How much are they?

a. 15 cents
b. 50 cents
c. 25 cents

**B. Count the perimeter of each shape and write the correct answer.**




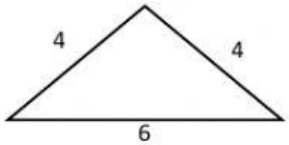


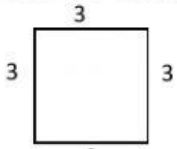


**C. Which measurement do you use to measure each item? Write inches/feet**

1. Height of a house _____
2. Height of a cat _____
3. Length of a car _____
4. Width of a book _____
5. Length of your pencil _____

**D. Read and solve**

1. Max has 3 dogs. He bought 9 dog biscuits. She gave the same number of biscuits to each dog. How many dog biscuits for each dog?

   _____

2. Lisa has 6 rabbits. She gave each rabbit 2 carrots. How many carrots in all?

   _____

LIVEWORKSHEETS