Interim 1 Review #2 Optional Name:_____

1

Mr. Jenkins went to a grocery store to buy milk for his restaurant.

- He bought 6 gallons of milk for the restaurant.
- After he bought this amount of milk, the restaurant had a total of 18 gallons of milk.

Which equation can be used to find the number of gallons of milk the restaurant had before Mr. Jenkins bought the milk at the grocery store?

St:
II BM NS-ST SS

Ⓐ $18 + 6 = \square$

Ⓑ $18 - 6 = \square$

Ⓒ $18 \div 6 = \square$

Ⓓ $18 \times 6 = \square$





2

A radio station had a contest and gave gift certificates to the winners. The names of the winners and their gift certificates are shown.

St:
PVC

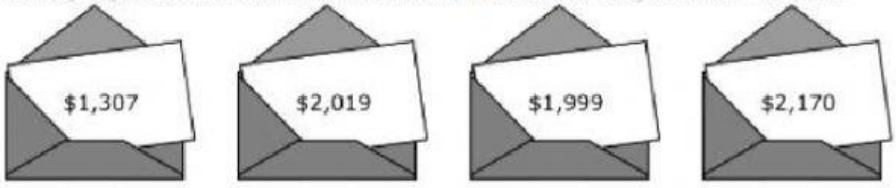

Who won gift certificates that were each worth more than $1,500 but less than $2,100?

Who won gift certificates that were each worth more than $1,500 but less than $2,100?

Ⓐ Christina and Paul only

Ⓑ Paul, Christina, and Roberto only

Ⓒ Roberto and Christina only

Ⓓ Scott, Christina, and Roberto only



LIVEWORKSHEETS

Interim 1 Review #2 Optional Name:_____



4

Oliver had 35 collectible baseball cards. He put them into a scrapbook. He put 7 baseball cards on each page.
How many pages did Oliver need for these baseball cards?

Ⓐ 5

Ⓑ 28

Ⓒ 42

Ⓓ Not here

St:
II BM NS-ST SS





7

How is 50,505 written in expanded notation?

Ⓐ $(5 \times 10{,}000) + (5 \times 1{,}000) + (5 \times 100)$

Ⓑ $(5 \times 10{,}000) + (5 \times 100) + (5 \times 1)$

Ⓒ $(5 \times 10) + (5 \times 10) + (5 \times 1)$

Ⓓ $(5 \times 10) + (5 \times 100) + (5 \times 1)$

St:
PVC



LIVEWORKSHEETS

Interim 1 Review #2 Optional Name:_____

8

St:
II BM NS-ST SS

Rita collected newspapers for recycling during two weeks.

- Week 1: She collected 219 newspapers.
- Week 2: She collected 36 fewer newspapers than in Week 1.

What was the total number of newspapers Rita collected during these two weeks?
Record your answer in the boxes below. Be sure to use the correct place value.







20

Tara has three packages of cheese. The list shows the weights of these packages of cheese.

2 pounds, 4 pounds, 3 pounds

The packages of cheese cost $4 per pound. What is the total cost of these packages of cheese?

St:
II BM NS-ST SS

Ⓐ $45

Ⓑ $13

Ⓒ $9

Ⓓ $36



LIVEWORKSHEETS

Interim 1 Review #2 Optional Name:_____

11

St:

Point V represents a fraction on the number line.



Which equivalent fraction can point V represent?

Ⓐ $\frac{8}{10}$

Ⓑ $\frac{4}{8}$

Ⓒ $\frac{4}{4}$

Ⓓ None of these



12

Workers at a factory put 8 phone cases in each box they send to a store. Which table shows the relationship between the number of boxes a store receives and the number of phone cases in these boxes?

Ⓐ

Phone Cases in Boxes				
Number of Boxes	3	5	7	9
Number of Phone Cases	11	13	15	17

Ⓑ

Phone Cases in Boxes				
Number of Boxes	2	4	6	8
Number of Phone Cases	16	17	18	19

Ⓒ

Phone Cases in Boxes				
Number of Boxes	16	32	48	64
Number of Phone Cases	2	4	6	8

Ⓓ

Phone Cases in Boxes				
Number of Boxes	3	5	7	9
Number of Phone Cases	24	40	56	72

St:
-Find the Rule
-Apply the Rule



LIVEWORKSHEETS

Interim 1 Review #2 Optional Name:_____



14

Heather has a collection of trading cards. The list gives information about the number of trading cards in Heather's collection.

- The number is greater than 4,271.
- The number is less than 4,309.

Which number could be the number of trading cards in Heather's collection?

Ⓐ 4,293

Ⓑ 4,230

Ⓒ 4,182

Ⓓ 4,410

St:
II BM NS-ST SS





15

There are 12 inches in every foot. Which table shows the relationship between inches and feet?



Ⓐ

Inches and Feet	
Number of Inches	Number of Feet
2	24
3	36
4	48
5	60

Ⓒ

Inches and Feet	
Number of Inches	Number of Feet
24	2
36	3
48	4
60	5

Ⓑ

Inches and Feet	
Number of Inches	Number of Feet
2	14
3	15
4	16
5	17

Ⓓ

Inches and Feet	
Number of Inches	Number of Feet
14	2
15	3
16	4
17	5

St:
-Find the Rule
-Apply the Rule

LIVEWORKSHEETS

Interim 1 Review #2 Optional Name:_____

15

Judy has a barrel in her backyard for collecting rainwater.

- On Wednesday morning, the barrel contained 23 gallons of water.
- During a rainstorm on Wednesday afternoon, more water was collected in the barrel.
- After the rainstorm, the barrel contained 31 gallons of water.

How many gallons of water were collected during the rainstorm on Wednesday afternoon?

(A) 8 gal

(B) 12 gal

(C) 54 gal

(D) 7 gal



St:
II BM NS-ST SS



17

When a shop opened on Monday, it had 493 candles for sale.

- By noon, 82 of the candles had been sold.
- At the end of the day, 247 of the candles had not been sold.

Which of these can be used to find the number of candles that were sold between noon and the end of the day?

St:
II BM NS-ST SS

(A)

493		
82	?	247

(B)

?		
493	82	247

(C) $493 - 82 + 247 = \square$

(D) $493 + 82 - 247 = \square$



LIVEWORKSHEETS

Interim 1 Review #2 Optional Name:_____

18

Eric has some coins in his pocket. The coins have a value of $1.29.
Which set of coins could NOT be the coins Eric has in his pocket?

Ⓐ 

Ⓑ 

Ⓒ 

Ⓓ 

St:
-Label the Money
-PVC



21

Luke has 2 packages of stickers.

- Each package has 5 sheets of stickers.
- Each sheet has 7 stickers.

What is the total number of stickers in the 2 packages Luke has?

Ⓐ 35

Ⓑ 49

Ⓒ 17

Ⓓ 70

St:
II BM NS-ST SS





LIVEWORKSHEETS

Interim 1 Review #2 Optional Name:_____

22

St:
II BM NS-ST SS

A store has 3 rows of tricycles for sale. There are 9 tricycles in each row, and each tricycle has 3 wheels. Which model can be used to find the number of wheels on all the tricycles?

Ⓐ

3	3	3	3	3	3	3	3	3
3	3	3	3	3	3	3	3	3
3	3	3	3	3	3	3	3	3

Ⓑ

9	9	9	9	9	9	9	9	9
9	9	9	9	9	9	9	9	9
9	9	9	9	9	9	9	9	9

Ⓒ

3	9
3	9
3	9

Ⓓ

9
9
9







LIVEWORKSHEETS