A **Aşağıdaki noktalı yerlere** "küçüktür", "büyüktür" **ifadelerinden uygun olanı örnekteki gibi yazalım.**

65, 76'dan küçüktür.	74, 47'den .....
93, 62'den	53, 25'ten .....
88, 89'dan	49, 94'ten .....
45, 39'dan	80, 59'dan .....
13, 31'den	92, 29'dan .....

B **Çiçeklerin üzerindeki sayıları büyükten küçüğe doğru örnekteki gibi sıralayalım.**



93 - 73 - 39 - 32



.....



.....



.....

.....

.....

C **Evlerin üzerindeki sayıları küçükten büyüğe doğru sıralayalım.**

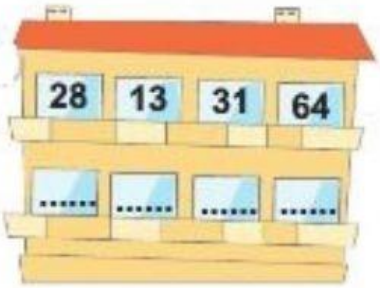

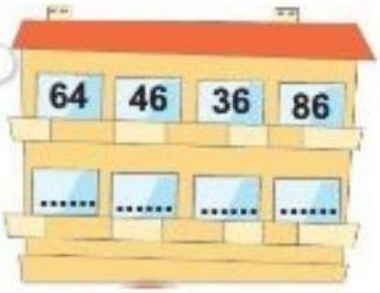

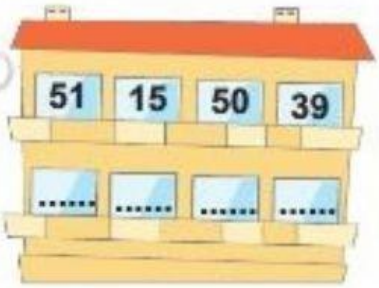

LIVEWORKSHEETS