Name: _____ Date: _____ Period: 1 2 5 6 7 8

Congruent Triangles

ASA, AAS, SAS, SSS

For each problem give the correct naming order of the congruent triangles. Write that name in order on the lines for the problem number (see box at bottom). Also, indicate which postulate or theorem that is being used.

1.

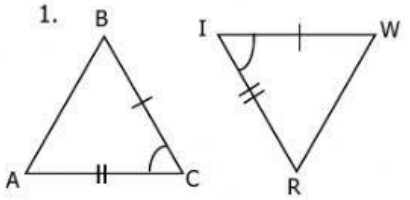

ΔABC ≅ Δ _____ by _____

2.

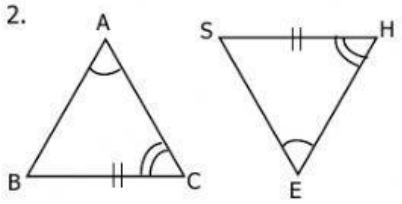

ΔABC ≅ Δ _____ by _____

3.

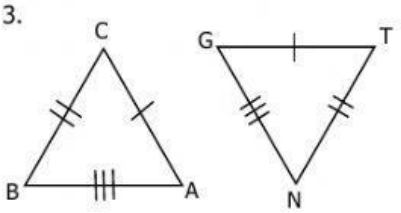

ΔABC ≅ Δ _____ by _____

4.

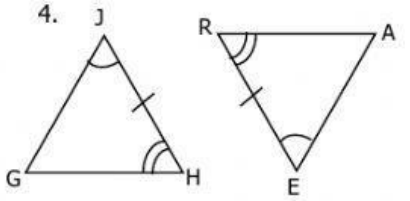

ΔGHJ ≅ Δ _____ by _____

5.

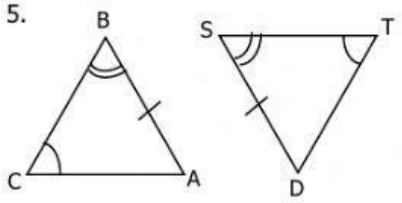

ΔABC ≅ Δ _____ by _____

6.

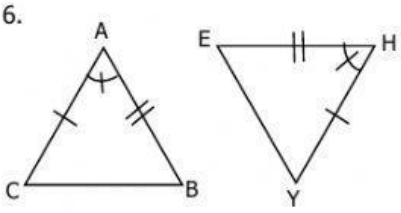

ΔABC ≅ Δ _____ by _____

7.

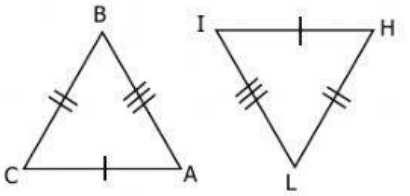

ΔABC ≅ Δ _____ by _____

8.

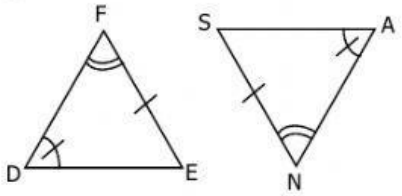

ΔDEF ≅ Δ _____ by _____

9.

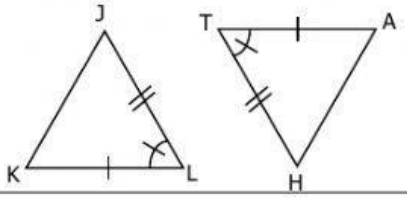

ΔJKL ≅ Δ _____ by _____

10.

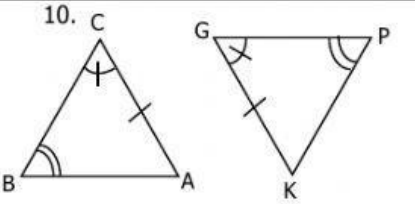

ΔABC ≅ Δ _____ by _____

11.

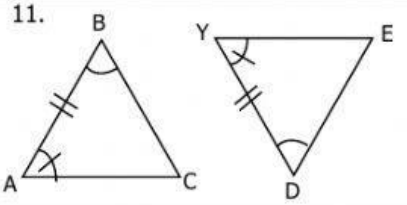

ΔABC ≅ Δ _____ by _____

12.

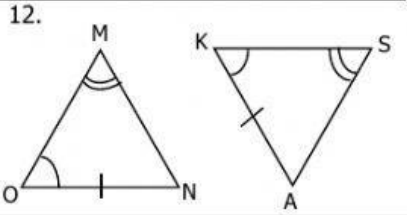

ΔMNO ≅ Δ _____ by _____

| | | |