Área del rectángulo y del cuadrado

1. Observa las medidas y calcula el perímetro y el área de cada figura.



Perímetro ▶

Área ▶



Perímetro ▶

Área ▶

2. calcula el área de cada figura.



Área ▶

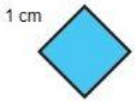

Área ▶

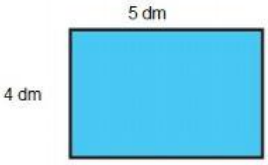

Área ▶

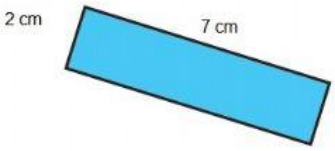

Área ▶

3. Observa la medida del lado del cuadrado y calcula.

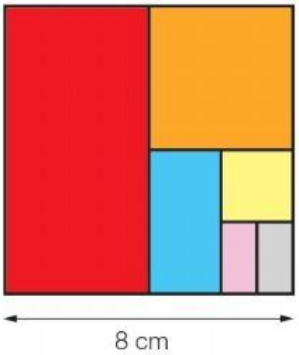

- El área de los rectángulos:

- El área de los cuadrados: