Кути утворені при перетині двох прямих січною

Знайдіть градусну міру невідомого кута х

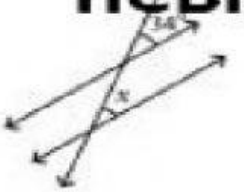

$x =$ _____

2)

$x =$ _____

3)

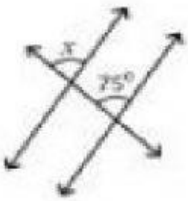

$x =$ _____

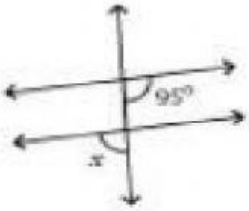

$x =$ _____

5)

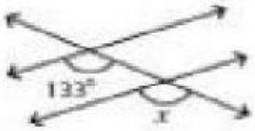

$x =$ _____

6)

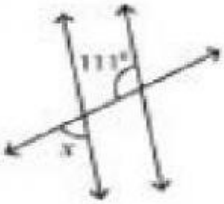

$x =$ _____

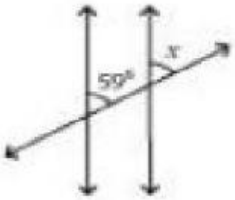

$x =$ _____

8)

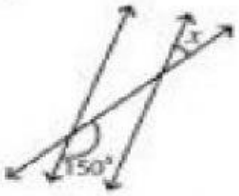

$x =$ _____

9)

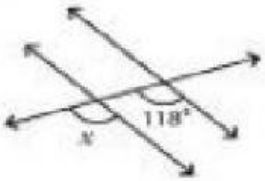

$x =$ _____

LIVEWORKSHEETS