THE SOLAR SYSTEM

Write and match.

⇨ planet ⇨ satellite ⇨ star

The Sun is a _____ ⇨ 

The Earth is a _____ ⇨

The Moon is a _____ ⇨

Label the planets.

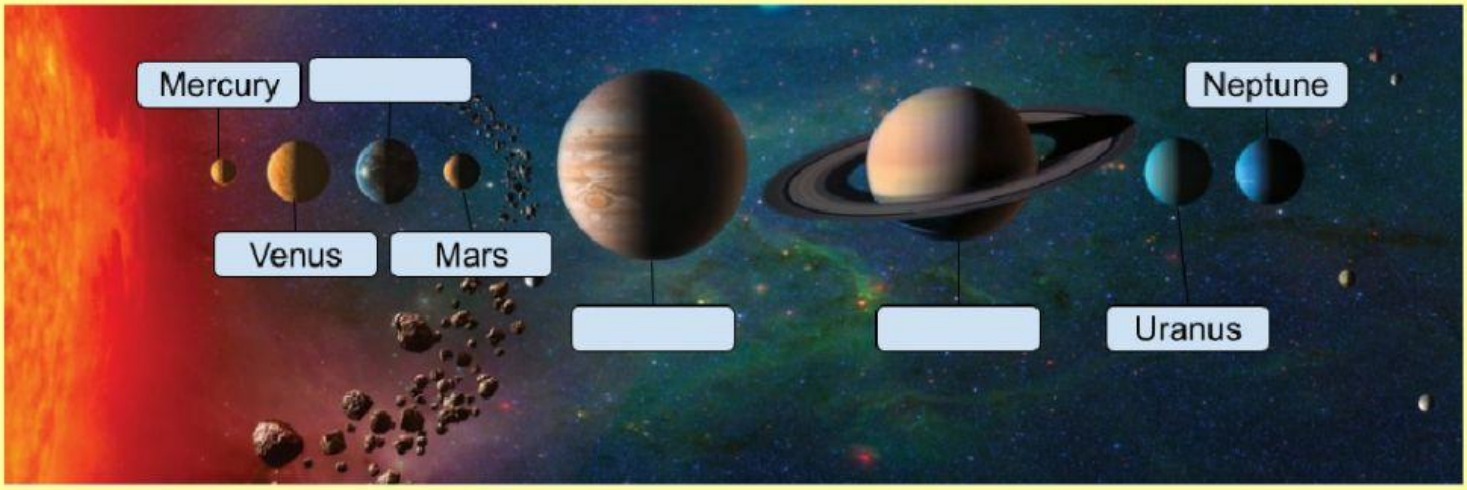

Match the Earth's movements.

- Rotation -

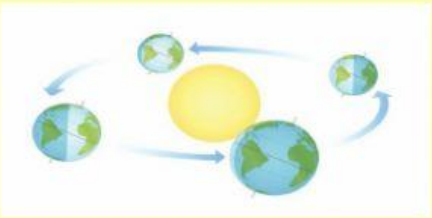

- Revolution -

LIVEWORKSHEETS

Write the phase of the moon(*New Moon* or Full Moon).

Match the layer of the Earth.

Core ►

Mantle ►

Crust ►

LIVEWORKSHEETS