Name: _____ Date: _____

The Earth (Lines of latitude & Longitude)

Choose the correct word that completes each sentence.

THE EARTH

The Earth is the _____ on which we live. It is shaped like a _____. One half of the earth is _____. The earth spins counterclockwise around the _____. The earth takes one _____ to spin around the sun. This is called _____. The earth also spins on its _____. This is called _____ and it takes one _____ to do this.

LINES OF LATITUDE & LONGITUDE

Drag the names of the lines of latitude into the correct position of the map.

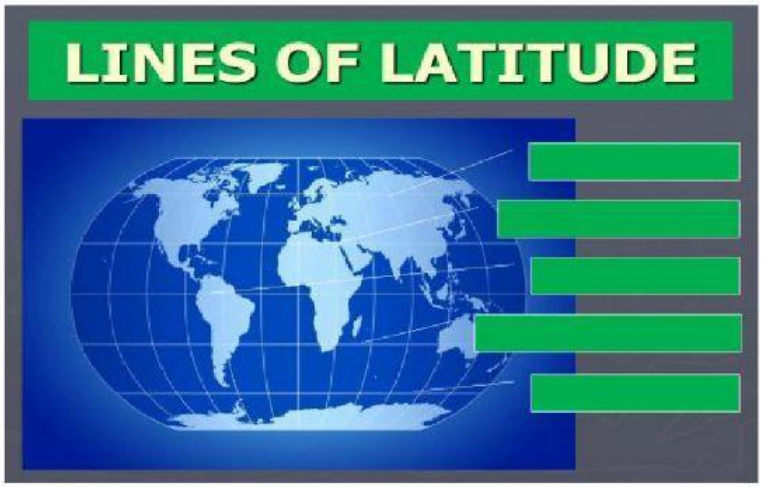

Equator
Tropic of Cancer
Tropic of Capricorn
Arctic Circle
Antarctic Circle

Choose the correct line of latitude of longitude to match the phrases below.

a) Measures 0° latitude _____

b) Measures 0° longitude _____

c) Runs through The Bahamas _____

LIVEWORKSHEETS

d) This line of latitude is found furthest north _____

Choose the correct word that describes the images below.

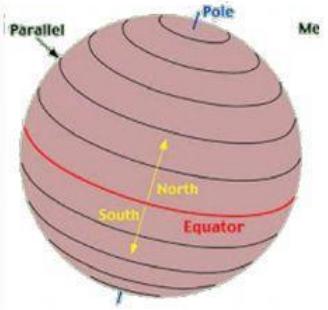

a.

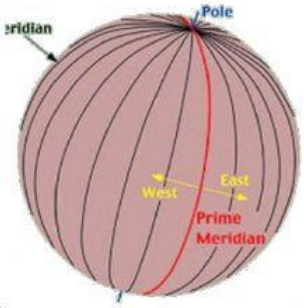

b.

LIVEWORKSHEETS