Volume Bangun Datar Sisi Ruang

Sebelum mengerjakan kuis, pahamilah video pembelajaran terlebih dahulu!

Video Pembelajaran

https://youtu.be/QZlr49NRV8w

Kuis 1

Pilihlah jawaban yang!

3. Tentukan volume bangun di bawah ini!

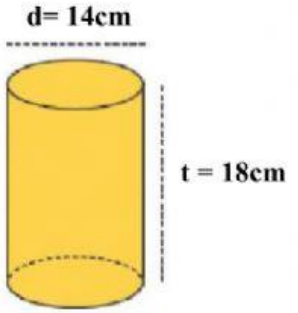

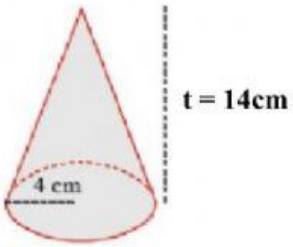

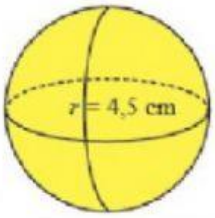

d. 318.8cm c. 821.8cm

b. 388.1cm a. 381.8cm

2. Pindahkan jawaban pada kotak kosong!



V = 324π

1. Tariklah garis pada jawaban yang benar!

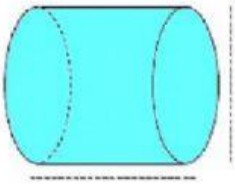

d =?

t = 12cm

V = 1848cm



t =?

V = 2355cm

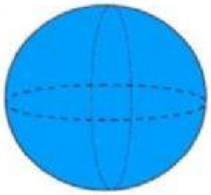

d =?

V = 1716.8cm

14 cm 10 cm 14 cm

LIVEWORKSHEETS