UNIT 3: ANIMALS IN THE WORLD 2019-2020

NAME:_____DATE:_____LIST NUMBER:____ MARK_____

1) NAME the five main GROUPS of VERTEBRATES: (0,5)

1)	2)	3)	4)	5)

2) Say if this statements are TRUE or FALSE.

FISH can take OXYGEN FROM WATER

Amphibians don´t change during their life cycle

Almost all amphibians are oviparous

Anura and Urodela are type of fishes.

Vertebrates and invertebrates have a backbone.

3) Drag and Drop the parts of the fish.

scales	flaps covering the gills	gills

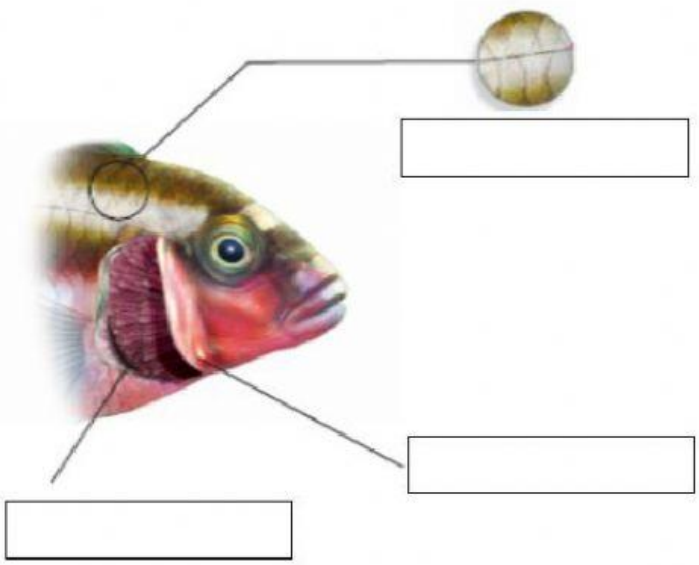

4) TICK the correct statement on why adult AMPHIBIANS NEED to BE NEAR WATER (0,5)

To keep their skin wet.

They cannot live out of water.

When They are adults only breathe under water.

5) TICK three sentences that talks about why FEATHERS are IMPORTANT for birds (0,75)

1) They attract a mate.
2) They feed their offsprings
3) They control their body temperature.
4) They help them to fly.
5) They are useful for hunting.

UNIT 3: ANIMALS IN THE WORLD 2019-2020

NAME:_____DATE:_____LIST NUMBER:____ MARK_____

6) Tell what to types of birds are?

_____birds and _____birds.

7) Join the correct sentences about CROCODILES and LIZARDS. (0,75)

CROCODILE	**STRONG JAWS**
CROCODILE	**SQUAMATA**
LIZARD	**CROCODILIA**
LIZARD	**SWALLOW THEIR PRAY.**

8) NAME the six main GROUPS of INVERTEBRATES: (0,6)

1) 2) 3) 4) 5) 6)

9) Label the parts of the bird

Lungs Backbone air sacks wings legs feathers



UNIT 3: ANIMALS IN THE WORLD 2019-2020

NAME:_____DATE:_____LIST NUMBER:____ MARK_____

10) DEPENDING on the TYPE of NUTRITION we can NAME different TYPES of ORGANISMS: (0,4)

Heterotrophic organisms			Autotrophic organisms
1	2	3	1

11) Match

herbivore carnivore decomposer producer omnivore

12) COMPLETE the diagram to show the feeding relationship between these living organisms in a forest: (0,5)
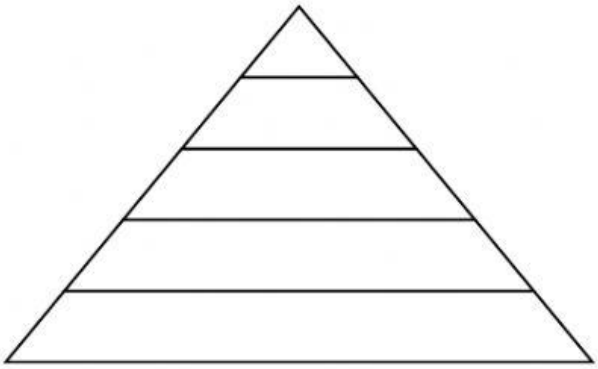
Grass rabbits foxes bears mushrooms