Observe las imágenes e indique el tipo de ángulos (agudo, recto, obtuso) y su medida aproximada.

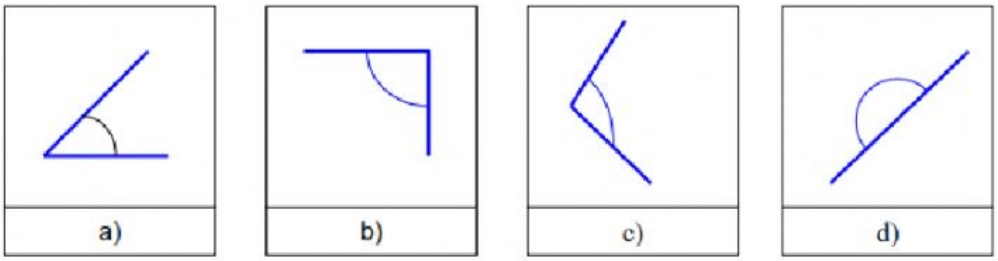

Observe los sectores oscuros del círculo e indique que tipo de ángulo es:

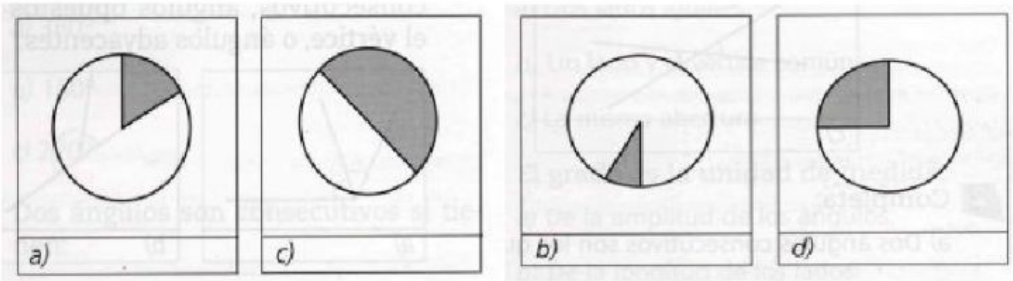

Colorea el elemento que se indica en cada caso´



LIVEWORKSHEETS

1.



2.

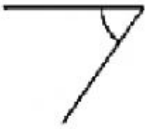

3.

4.



5.

6.

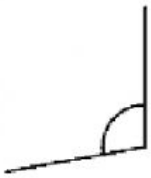

7.

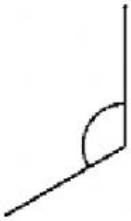

8.

9.

10.

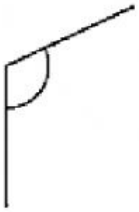

11.

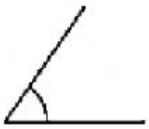

12.

LIVEWORKSHEETS