Tarea #2 de matemáticas

Valor: 3%

Ubique y escriba cada número decimal de la lista en la recta numérica, recuerde anotar la coma decimal.

8,7 – 8,55 – 8,24 - 8 – 8,92 - 8,15 – 8,33 – 8,81 - 8,48 – 9 – 8,06 - 8,6

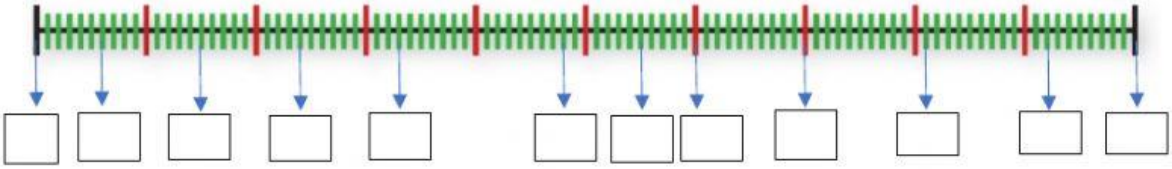

2,5 – 4,7 – 3,2 – 4 - 4,2 - 3,7- 5

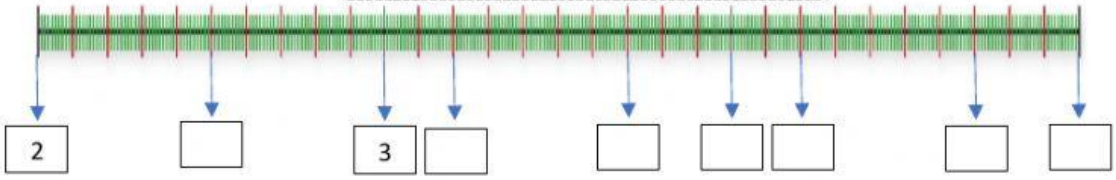

Escriba en el recuadro el número decimal que esta representado por el punto.

a-)

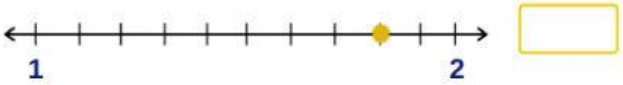

b-)

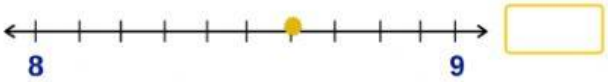

c-)

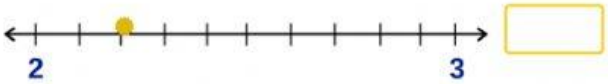

LIVEWORKSHEETS