FICHA DE INTERVALOS. 4º ESO

1. Relaciona cada intervalo con su respectiva representación gráfica:

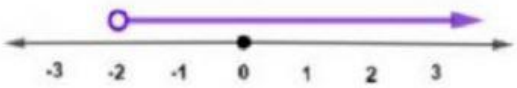

(-1,3)

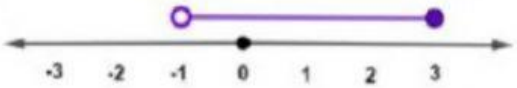

[-1,3)



(-2,∞)

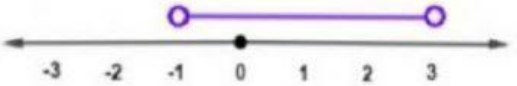

[-1,3]

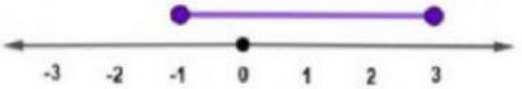

(-∞,2]

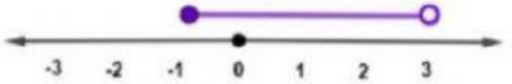

(-1,3]

LIVEWORKSHEETS

FICHA DE INTERVALOS. 4º ESO

2. Completa la siguiente tabla

$(-1, +\infty)$ $(-1, 4]$ $(-\infty, -1]$

$[-1, 4)$ $(-1, 4)$ $[-1, 4]$

$-1 \leq x \leq 4$ $-1 < x < 4$ $-1 \leq x < 4$

$x \leq -1$ $-1 < x \leq 4$ $x > -1$

Intervalo	Forma gráfica	Forma algebraica
$(-1, 4)$		
		$-1 \leq x \leq 4$
$(-1, 4]$		
		$x \leq -1$

LIVEWORKSHEETS