X හි අගය දැක්වෙන කෝණයට රූපය යා කරන්න.

1)

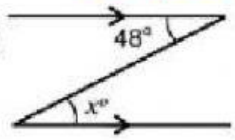

2)

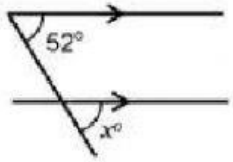

3)

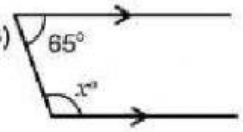

4)

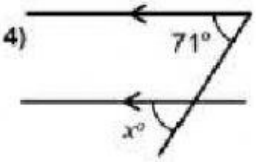

කෝණ වල අගයයන් හිස් තැන් වල type කරන්න

5)

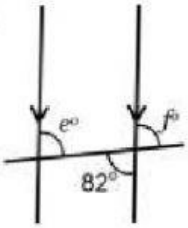

e=

f=

6)

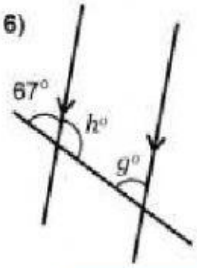

h=

g=

7)

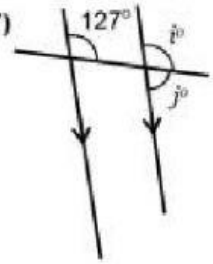

i=

j=

8)

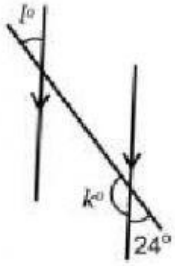

k=

l=

LIVEWORKSHEETS