Name: Class: Date:

Patterns and Symmetry

Worksheet 2

1. Draw the lines of symmetry of the following figures:.



2. Draw the lines of symmetry for the following figures.

(a)

(b)

(c)

LIVEWORKSHEETS

L2 Worksheet 2

1 Count the number of quarter turns made and state if the turns made are clockwise or anti-clockwise. Write the size of each angle made.

(a) has been done for you.

(a) 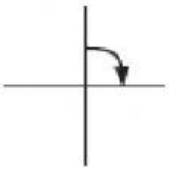 $\frac{1}{4}$ turn clockwise $\frac{1}{4}$ turn = 90°	**(b)** 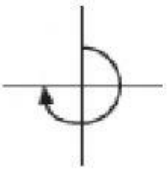 $\frac{3}{4}$ turn _____ $\frac{3}{4}$ turn = _____
(c) 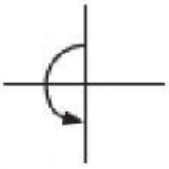 $\frac{1}{2}$ turn _____ $\frac{1}{2}$ turn = _____	**(d)** 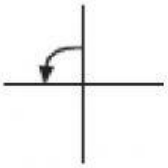 $\frac{1}{4}$ turn _____ $\frac{1}{4}$ turn = _____
(e) $\frac{3}{4}$ turn _____ $\frac{3}{4}$ turn = _____	**(f)** 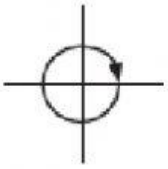 1 complete turn _____ full turn = _____

LIVEWORKSHEETS