Name: _____ Section: _____

REINFORCEMENT WORKSHEET # 2

Question # 1: **Guess the correct operations for the given situations.**

a) **Maha bought a cake. She gave $\frac{2}{5}$ of cake to her sister.**
How much cake is left with her?

Addition | Subtraction

b) **On Sunday, Alina spent $\frac{2}{4}$ hours for the preparation of Mathematics test and $\frac{1}{5}$ hours for preparation of Urdu test. Rest of the time she played.**
How much time did she study?

Addition | Subtraction

c) **Ali ran $7\frac{3}{4}$ km yesterday and $3\frac{1}{2}$ km today.**
How much more distance did he cover yesterday?

Addition | Subtraction

d) **Sana had $\frac{6}{8}$ of a pack of sweets. She ate one-quarter of sweets from the pack.**
How many sweets were there now?

Addition | Subtraction

e) **For baking, Zaina used 6 cups of flour for cake and $\frac{7}{4}$ cups of flour for brownies.**
How much flour did she use in all?

Addition | Subtraction

LIVEWORKSHEETS

Question # 2: Match the columns.

COLUMN A	COLUMN B
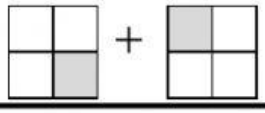	three fifths
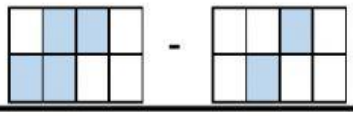	two quarters
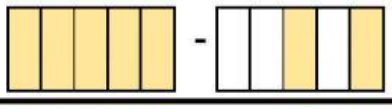	one whole
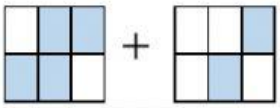	two eighths

Question # 3: **Choose the best option.**

★ $\frac{1}{4} + \frac{1}{4} + \frac{1}{4} + \frac{1}{4}$ **is same as:**

a) 1 whole

b) 4 groups of one-fourth

c) All of these

★ **Subtraction of four fifths from 2 wholes is same as:**

a) $\frac{4}{5} - 2$

b) $2 - \frac{4}{5}$

c) $\frac{4}{5} + \frac{4}{5}$

★ **What is LCM of denominators in the question:** $\frac{1}{6} + \frac{1}{16}$

a) **48**

b) **16**

c) **2**

LIVEWORKSHEETS

★ $\frac{1}{5} + \frac{1}{5}$ **is equal to:**

a) $\frac{2}{10}$

b) $\frac{2}{5}$

c) $\frac{2}{25}$

★ **For adding or subtraction like fractions, we will :**

a) add or subtract their numerators

b) add or subtract their denominators

c) add or subtract both their numerators and denominators

★ **What should be added to one-half to make it 1 whole?**

a) 1 whole

b) One-half

c) Two-halves

★ **How many times one-eighth will be added to make it two-eighths?**

a) 1

b) 8

c) 2

★ **The simplest/lowest/reduced form of** $\frac{12}{48}$ **?**

a) $\frac{6}{24}$

b) $\frac{3}{12}$

c) $\frac{1}{4}$

LIVEWORKSHEETS