Codeyoung

Concept CW_Grade-7_Perimeter and Area

Basics of Circumference of Circles

Simplify the equations using exponents

Find the area of the given circles. (Use π as 3.14)

1

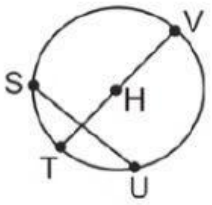

HV=1.3 ____

2

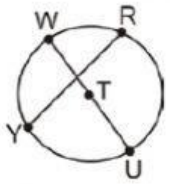

TU=4

3

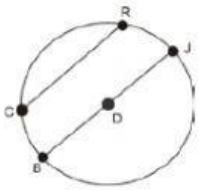

DJ=1.3 ____

4

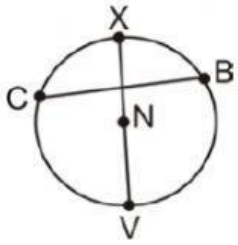

NV=2.3

5

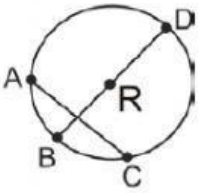

RD=3.2 ____

6

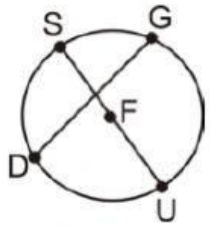

FU=4.2

7

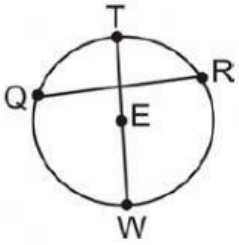

EW=1.6 ____

8

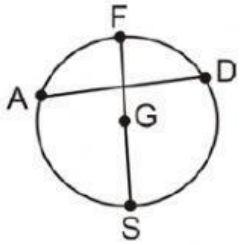

GS=6.5

9

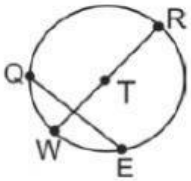

TR=5.2 ____

10

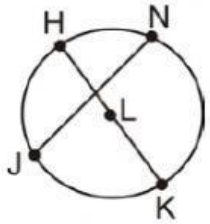

LK=7.2

LIVEWORKSHEETS

Codeyoung

Solve.

1	The diameter of the circle is 20.5 inches. Find the area of the circle.
2	The diameter of the circle is 14 inches. Find the area of the circle.
3	The diameter of the circle is 9.4 inches. Find the area of the circle.

LIVEWORKSHEETS