Codeyoung

# Concept CW_Grade-7_Perimeter and Area

## Basics of Area of Triangles

Find the area and perimeter of the following triangles (not drawn to scale).

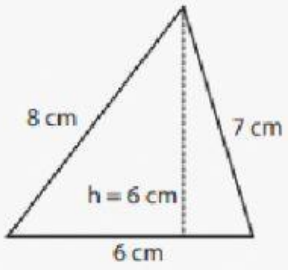


Perimeter:_____

Area:_____

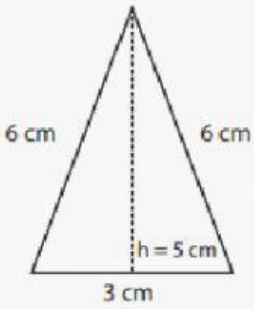


Perimeter:_____

Area:_____

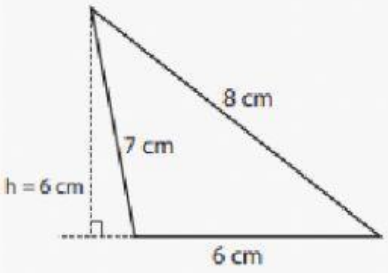


Perimeter:_____

Area:_____

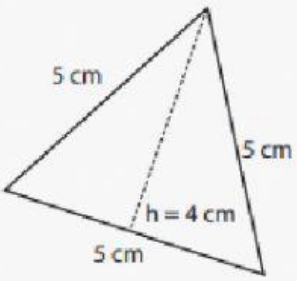


Perimeter:_____

Area:_____

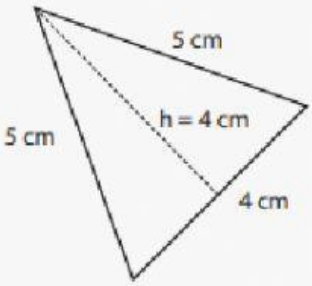


Perimeter:_____

Area:_____

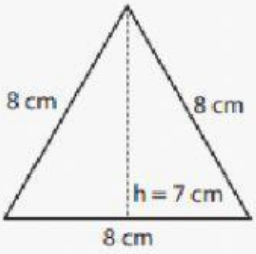


Perimeter:_____

Area:_____

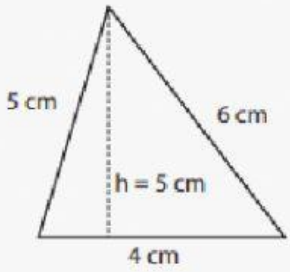


Perimeter:_____

Area:_____

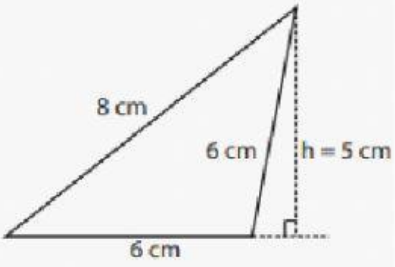


Perimeter:_____

Area:_____

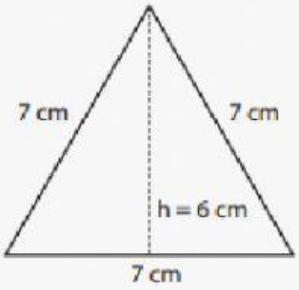


Perimeter:_____

Area:_____

LIVEWORKSHEETS

Codeyoung

Find the area of the following triangles (not drawn to scale).

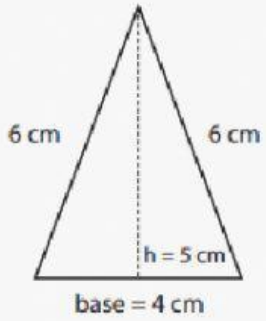


Area: _____

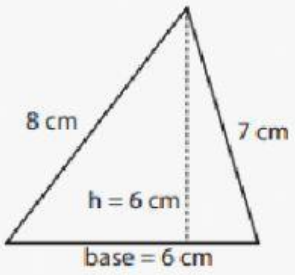


Area: _____

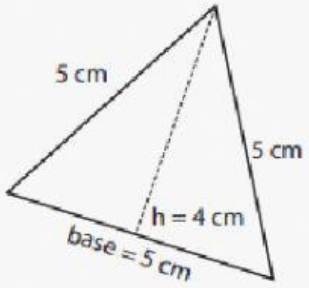


Area: _____

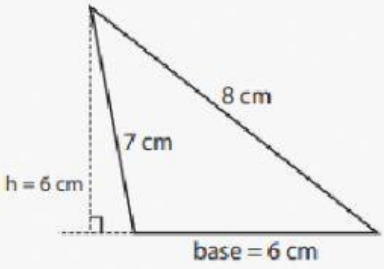


Area: _____

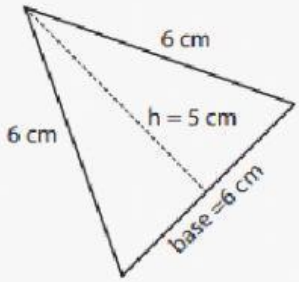


Area: _____

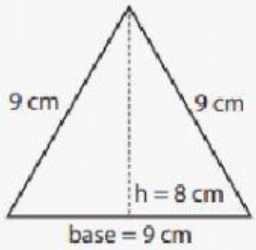


Area: _____

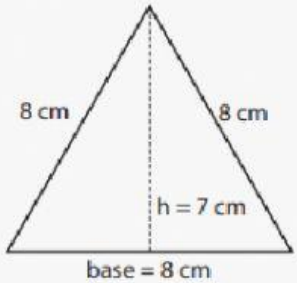


Area: _____

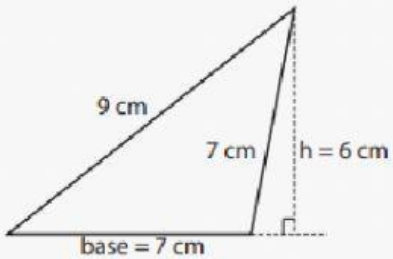


Area: _____

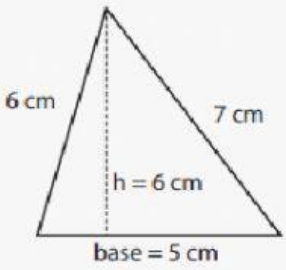


Area: _____

LIVEWORKSHEETS