Magister José Luis López López

INSTRUCCIONES: Calcule el perímetro de las siguientes gráfica y escriba la respuesta correcta en el espacio en blanco; tomando en cuenta que vamos a utilizar x pasra calcularlo.



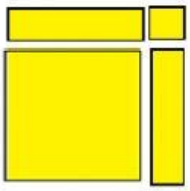





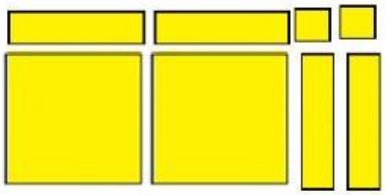

LIVEWORKSHEETS