Bài 2
Các số 6, 7, 8, 9, 10

Bài 1: Số?

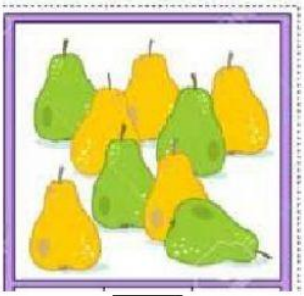

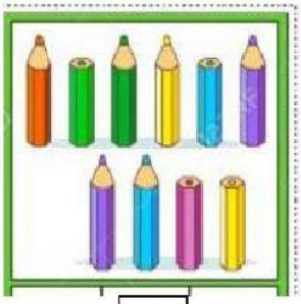



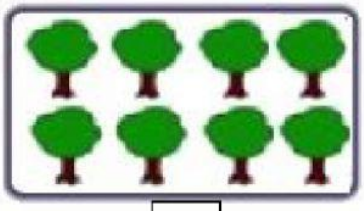

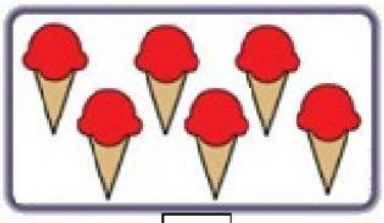

Bài 2: Số?

0	1	2			5			8		10

10	9			6					1	

Bài 3: Cho thêm mấy quả táo để trong giỏ có 7 quả táo.

Bài 4:

- Số bé nhất có 1 chữ số là: .....
- Số lớn nhất có 1 chữ số là: .....

LIVEWORKSHEETS