2. XYZ and PQR are isosceles triangles.

(a)

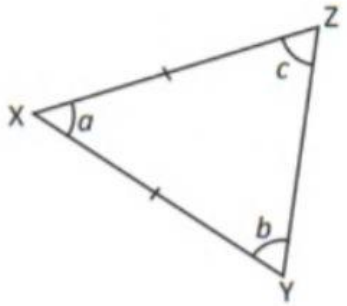

Which two sides are equal?

_____

Which two angles are equal?

_____

(b)

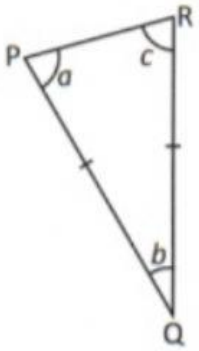

Which two sides are equal?

_____

Which two angles are equal?

_____

3. ABC is an equilateral triangle.

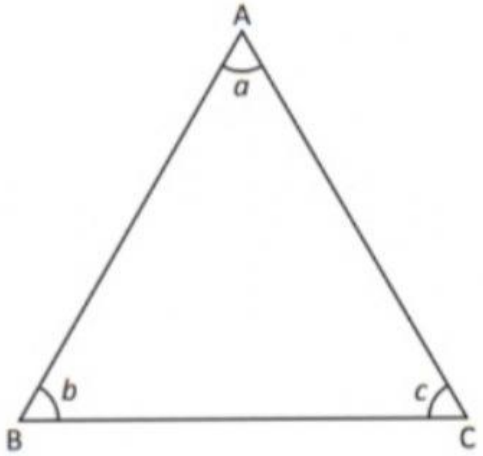

(a) Which angles are equal to $\angle a$?

_____

(b) Which sides are equal to AB?

_____

(c) What can you say about the angles in Triangle ABC?

_____

LIVEWORKSHEETS