GRADO 1 – INFORMÁTICA – EL MONITOR

1. Señala las figuras que corresponden al monitor de una computadora (Monitor CRT o Monitor Plano)



2. Escribe frente a cada imagen la cantidad de monitores que aparecen



_____



_____



_____

_____

_____

3. Señala el monitor que está encendido