GEOMETRIA – GORPUTZ GEOMETRIKOAK

- Poliedroak eta gorputz biribilak -

1. Esan gorputz geometriko hauek poliedroak ala gorputz biribilak diren.



2. Idatzi geziek seinalatzen duten piramide honen elementuen izenak.

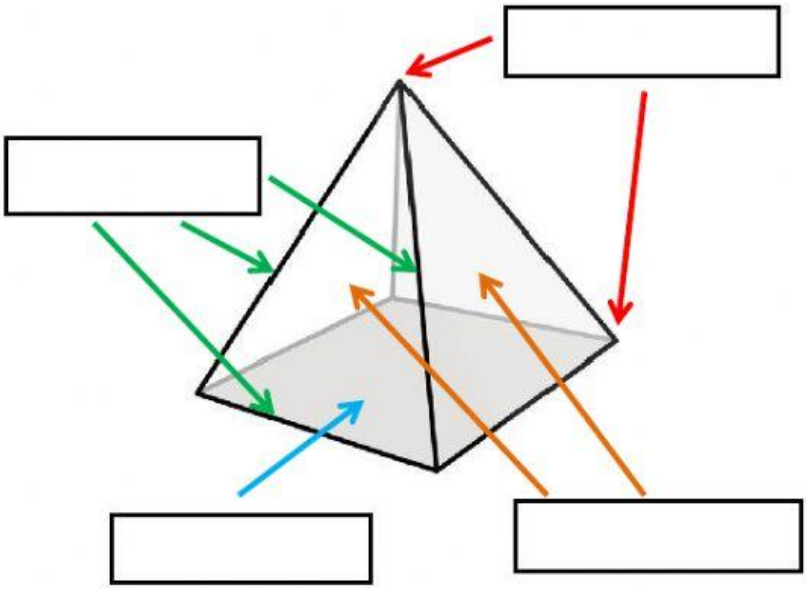

ALBOKO AURPEGIAK

ERPINAK

ERTZAK

OINARRIA

LIVEWORKSHEETS
LIVEWORKSHEETS

3. Osatu prisma eta piramide hauen taulak dagokion informazioarekin.

	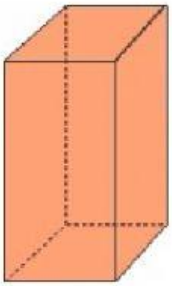			
OINARRIKO POLIGONOA	Laukia			
POLIGONOAREN IZENA	Prisma laukiarra			Prisma hexagonala
AURPEGI KOPURUA (Oinarriak eta aldeak)	6		7	
ERTZ KOPURUA	12			18
ERPIN KOPURUA	8	6		

	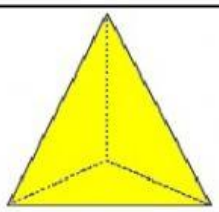	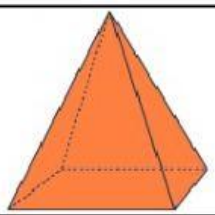	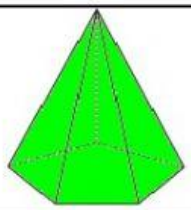	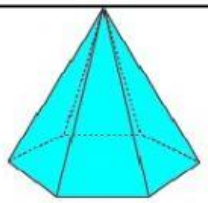
OINARRIKO POLIGONOA	Triangelua			
POLIGONOAREN IZENA			Piramide pentagonala	
AURPEGI KOPURUA (Oinarriak eta aldeak)	4			
ERTZ KOPURUA		8		
ERPIN KOPURUA				7

4. Lotu esaldi hauek dagokien gorputz biribilarekin.

Bi oinarri zirkular eta paralelo ditu.

Ez dauka ez ertzik ez erpinik.

Piramide baten itxurakoa da, baina oinarri zirkularrarekin.

Guztiz biribila da.

Oinarri bakarra du.

KONOA

ESFERA

ZILINDROA

LIVEWORKSHEETS
LIVEWORKSHEETS