5 Escribo en el espacio en blanco el número que falta para completar 10.

(1) 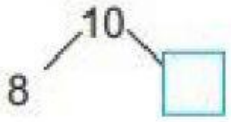

(2) 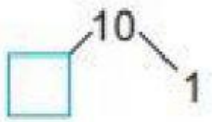

(3) 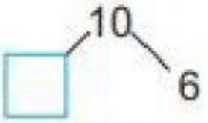

(4) 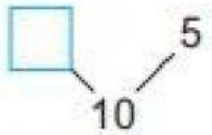

(5) 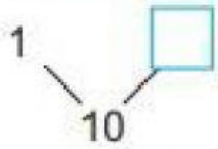

(6) 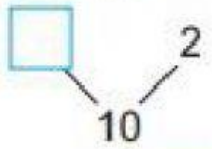

(7) 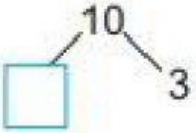

(8) 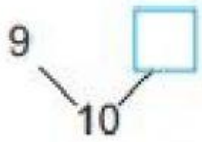

(9) 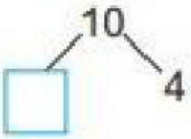

(10) 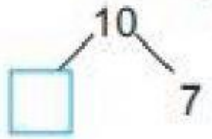

(11) 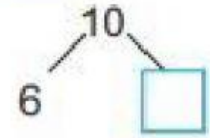

(12) 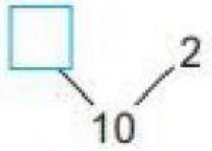

6 Encuentro el número que falta para formar 10.

(1) $3 + \square = 10$

(2) $\square + 4 = 10$

(3) $\square + 1 = 10$

(4) $8 + \square = 10$

(5) $\square + 6 = 10$

(6) $\square + 9 = 10$

(7) $5 + \square = 10$

(8) $2 + \square = 10$

LIVEWORKSHEETS