Ayuda a Watson a realizar estos ejercicios para conseguir otra pista de su caso

1. **Indica el tipo de ángulo que ves a continuación.**

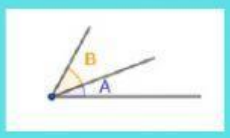

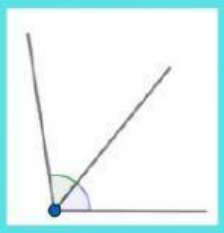

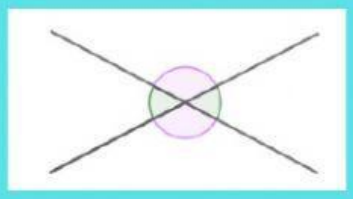



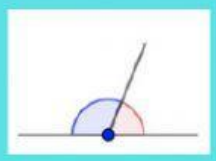

2. Indica en cada caso, la medida del ángulo o ángulos solicitados. Y une con el tipo de ángulos (puede unirse con dos tipos)

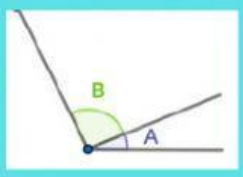

El ángulo B mide 85º y el A mide 22º.
¿Cuánto miden juntos?

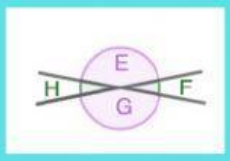

El ángulo E mide 154º.
¿Cuánto mide el G? ¿Y el H?

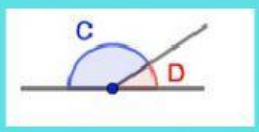

El ángulo D mide 34º .
¿Cuánto mide el C?

consecutivos

adyacentes

complementarios

suplementarios

opuestos por el vértice

3. Selecciona la opción correcta en cada caso

Recta tangente



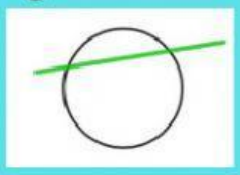

Rectas secante

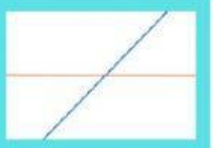

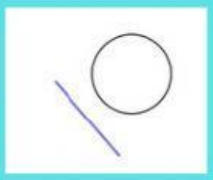

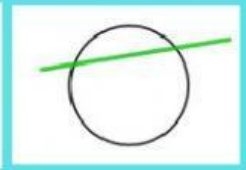

Recta exterior





Rectas perpendiculares

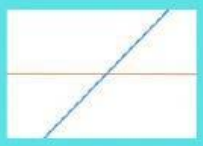

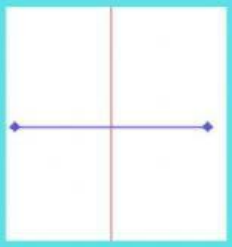

LIVEWORKSHEETS