¿QUÉ HORA ES?

1. COLOCA CADA CARTEL DÓNDE CORRESPONDA.

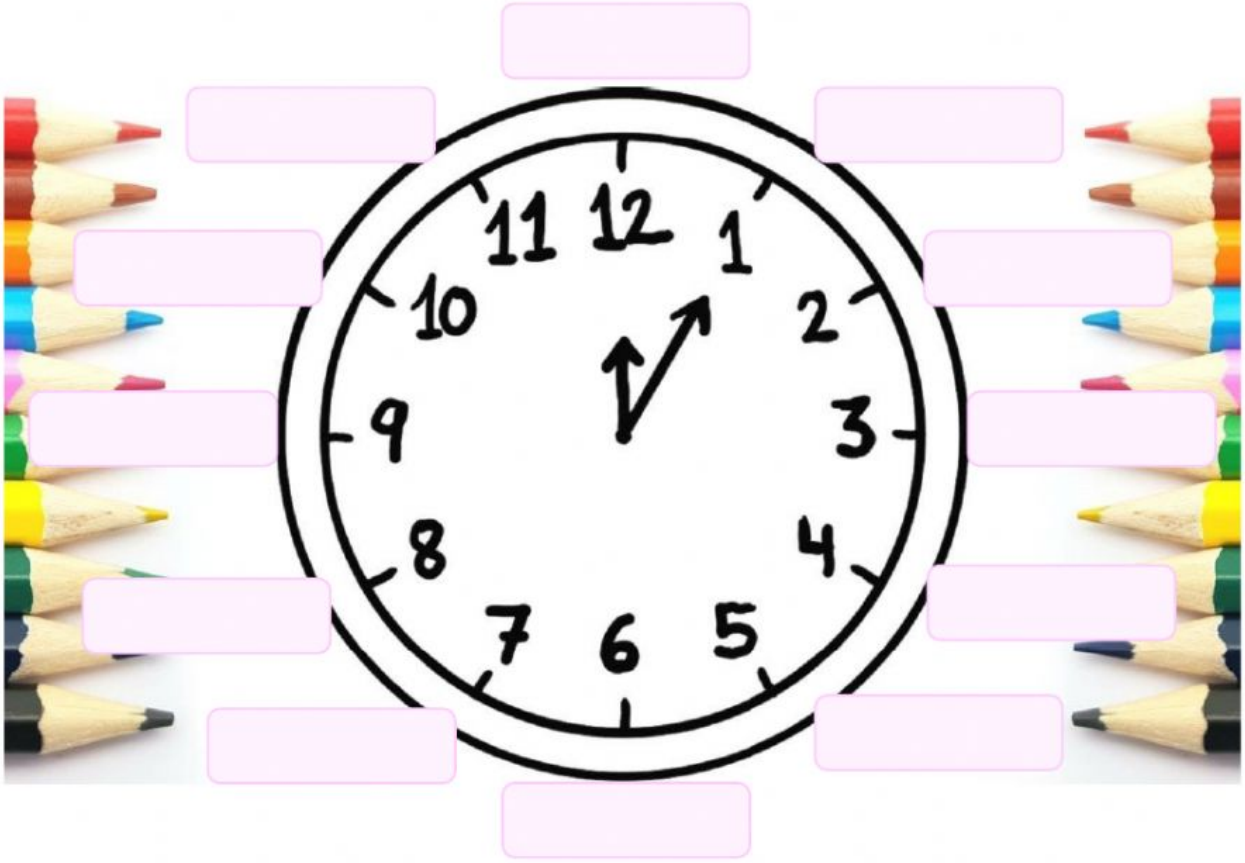

Y media	Y veinte	Menos cinco	Y cuarto	Y veinticinco	Y cinco
Menos cuarto	Menos diez	En punto	Menos veinticinco	Y diez	Menos veinte

2. COLOCA CADA HORA DONDE CORRESPONDA.

17 : 00

20 : 00

12 : 00

3. RELACIONA CADA RELOJ ANALÓGICO CON EL RELOJ DIGITAL.

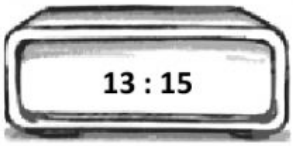

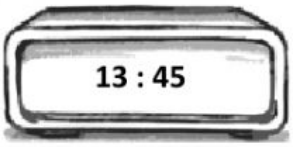





4. RELACIONA CADA RELOJ ANALÓGICO CON EL RELOJ DIGITAL.

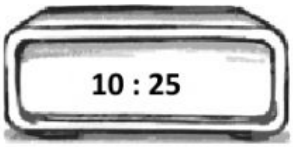

Son las cinco y veinte de la tarde

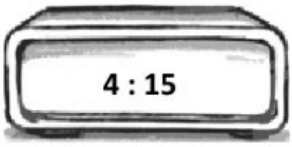

Son las diez y veinticinco de la mañana

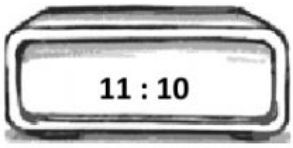

Son las ocho y media de la noche

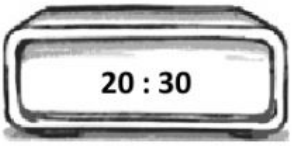

Son las once y diez de la mañana

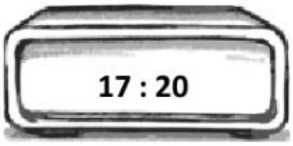

Son las cuatro y cuarto de la madrugada



Es la una y cinco