Mixed numbers and Improper fractions

Remember:

A mixed number is a whole number and a proper fraction combined. An improper fraction is when the numerator is greater than or equal to the denominator.

Let's Practice

Choose the mixed numbers:

$3\frac{4}{7}$ $\frac{10}{3}$ $\frac{41}{10}$ $\frac{5}{5}$ $5\frac{1}{2}$

Let's Practice

Choose the improper fractions:

$\frac{23}{7}$ $8\frac{3}{4}$ $\frac{37}{11}$ $6\frac{5}{9}$ $\frac{17}{17}$

How do I know what mixed number the graph is representing?

- First, count how many wholes.

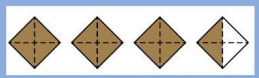

- Then, see what fraction is left.

$3\frac{2}{4}$

Let's Practice

What mixed number are these?

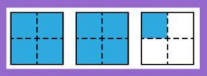

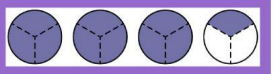

___ ___

Let's Practice More

What mixed number is this?

___

LIVEWORKSHEETS