# SCHOLASTIC ACADEMY

**WEEKLY TEST**

**FRIDAY 11TH JUNE, 2021**

## Mathematics

Marks:_____

Out of: 20

Grade:

**A. <u>Put the objects in order from GREATEST to LEAST capacity.</u>**

| | | | |
|---|---|---|---|
| | | | |

/2

**B. <u>Put the objects in order from LEAST to GREATEST capacity.</u>**

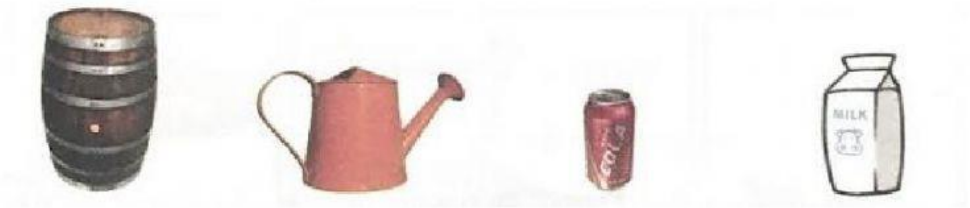


| | | | |
|---|---|---|---|
| | | | |

/2

**C. <u>Solve the following sum.</u>**

It takes **3 cups** to fill 1 bowl.


The capacity of the jug is **4 times** the bowl.

How many cups will it take to fill the jug?

_____ cups

/2

LIVEWORKSHEETS

**D. Choose the best unit of measurement for the following.**

| | | |
|---|---|---|
| Distance travelled by a plane | Length of a pair of scissors | Width of a shirt |
| km \| m \| cm | km \| m \| cm | km \| m \| cm |
| Height of a tree | Distance driven from Toco to Arima | Height of a house |
| km \| m \| cm | km \| m \| cm | km \| m \| cm |

/6

**E. Measure the length of each pencil below.**

| | |
|---|---|
| 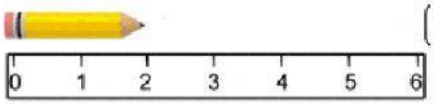 | ____ cm |
| 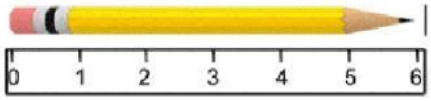 | ____ cm |
|  | ____ cm |
| 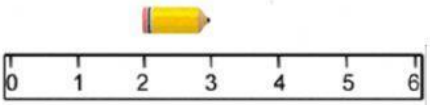 | ____ cm |

/6

**F. Find the area of the following shapes.**



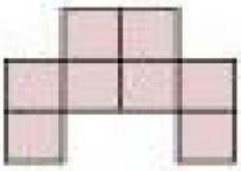

_____ square units

_____ square units

/2

LIVEWORKSHEETS