WORKSHEET

Class : V **Name : _____**

Subject: Maths **Topic: Parts and Whole**

- **Look at the given picture and Drag the correct equivalent fraction**

1/2 = 4/8 1/4 = 2/8 2/5 = 4/10 3/4 =6/8 2/6 = 4/12

1. 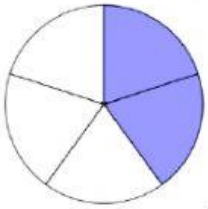 = 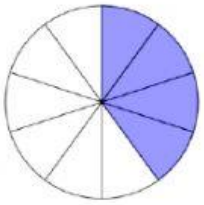 = _____

2. 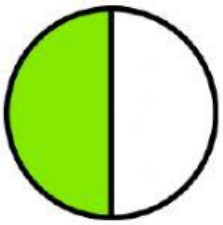 = 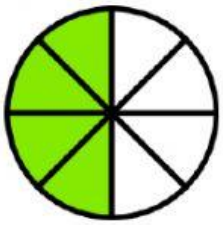 = _____

3. 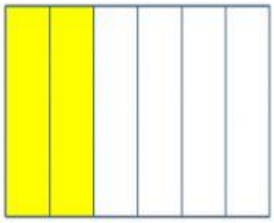 = 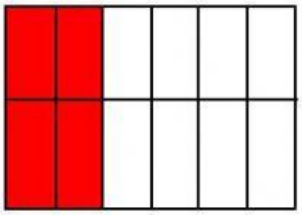 = _____

4 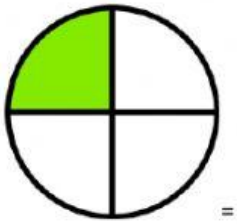 = 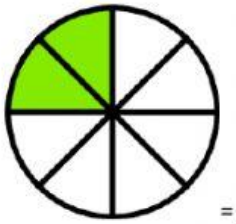 = _____

5. 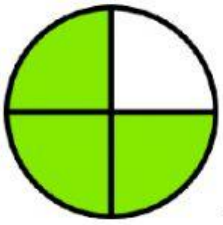 = 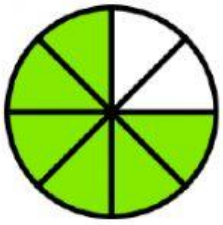 = _____

LIVEWORKSHEETS